15/03/2021

Matemática

Tema #19: Suma de los ángulos internos de un triángulo

Actividad: Cálculo de los ángulos internos de un triángulo

1. ¿Cuánto mide **x** en los siguientes triángulos?

a)

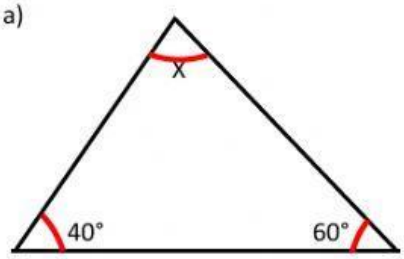

b)

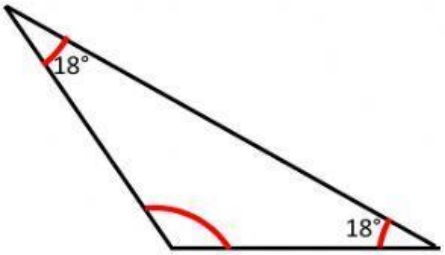

c)

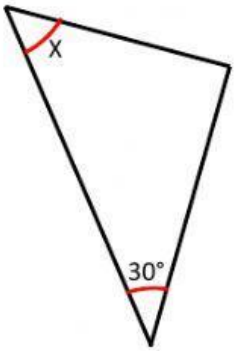

d)

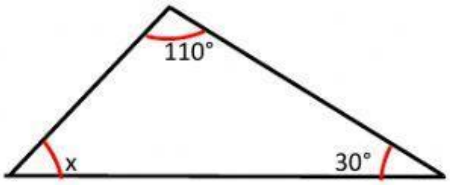

e)

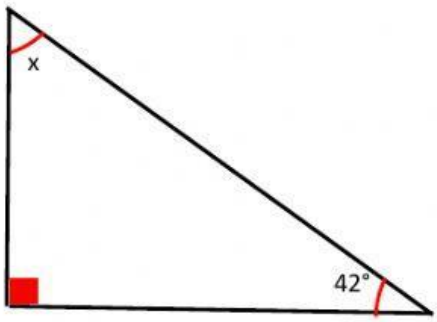

LIVEWORKSHEETS