Pythagorean Theorem Homework (c)

Solve for C (round to the nearest 10th):

(1)

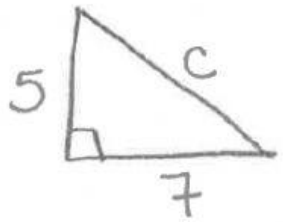

(2)

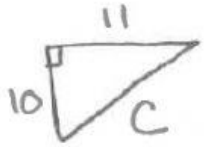

(3)

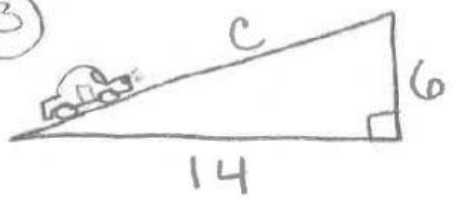

(4)

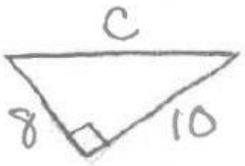

Create your own right triangles, then solve for c:

(Pick your own values for a and b)

(5)

(6)

LIVEWORKSHEETS