PRISMA

Ayo Kita Belajar !

No.	Prisma	Luas alas (L_a)	Ukuran tinggi (t)	Volume (V)
2.	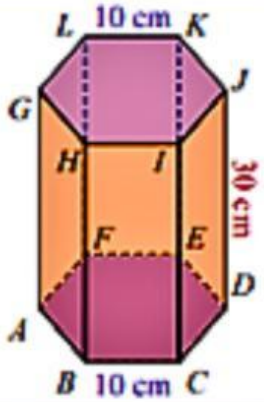	$L_a = 6 \times \frac{1}{2} \times 10 \times 5\sqrt{3}$ $= 150\sqrt{3}$	$t = 30$	$V = 6 \times (\frac{1}{2} \times 10 \times 5\sqrt{3}) \times 30$ $= (150\sqrt{3}) \times 30$ $= 4.500\sqrt{3}$ cm³
2.a	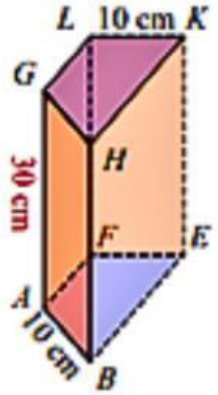	$L_a = \frac{1}{2} \times 150\sqrt{3}$ $= 75\sqrt{3}$	$t = 40$	$v = \cdots [6 x (\frac{1}{2} x 10x \ldots x30)$ $v = \cdots$
2.b	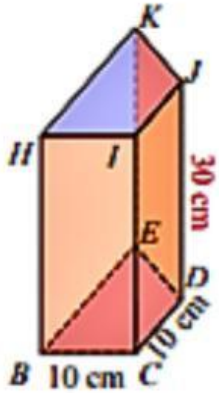	$L_a = \frac{1}{2} \times 150\sqrt{3}$ $= 75\sqrt{3}$	$t = 40$	$v = \cdots [6 x (\frac{1}{2} x 10x \ldots x30)$ $v = \cdots$

LIVEWORKSHEETS