# PECAHAN

NAMA : .....

KELAS : .....

## SOAL PECAHAN ITU MUDAH!

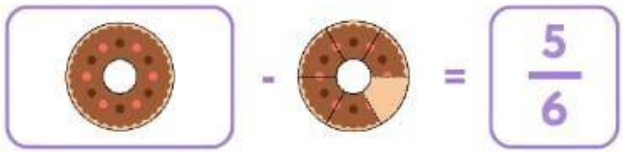


**1** Budi mempunyai 10 permen. Ia memutuskan untuk berbagi setengah bagian dengan adiknya. Berapa permen yang diberikan Budi?

**2** Andi memiliki 12 potong coklat. Andi meminta Joko mengambil $\frac{1}{2}$ dari coklat tersebut. Berapa coklat yang harus diambil Joko?




**3** Ibu membuat 8 potong pizza. Ibu memberikan $\frac{1}{4}$ dari pizza tersebut kepada Siti. Berapa potong pizza yang diberikan Ibu kepada Siti?

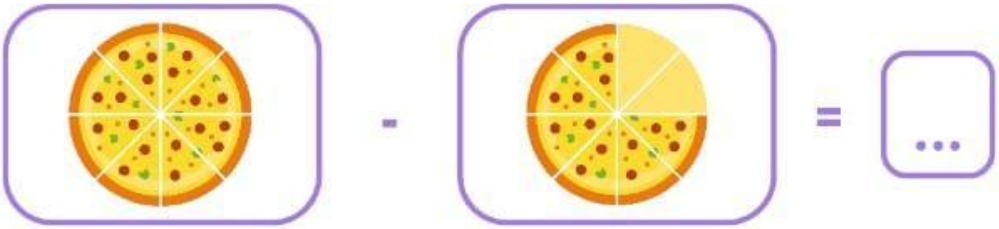


LIVEWORKSHEETS

# Pecahan Biasa

Hubungkan gambar sisa potongan pizza dengan pecahan yang tepat.

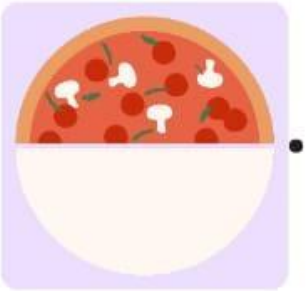



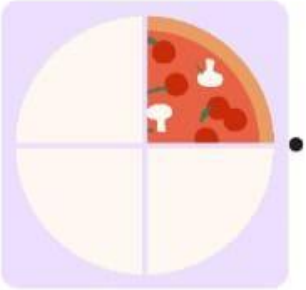

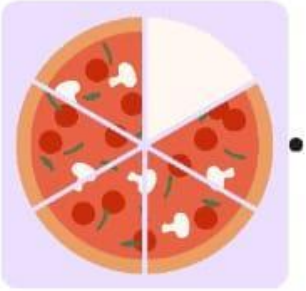

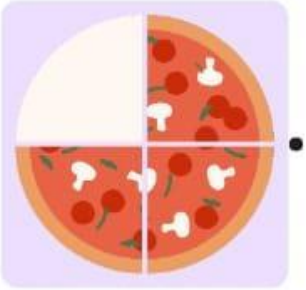

$\frac{1}{1}$

$\frac{3}{4}$

$\frac{1}{2}$

$\frac{5}{6}$

$\frac{1}{4}$

LIVEWORKSHEETS