Revision in Maths

Name:_____

True or False.

2 x 2 = 6 _____

10 x 10 = 100 _____

10 x 8 = 80 _____

2 x 5 =10 _____

5 x 6 = 40 _____

5 x 5 = 25 _____

2 x 4 =6 _____

10 x 7 =90_____

10 x 4 =50 _____

5 x 7= 35 _____

Write the missing numbers.

234		236	237	

192	193		195	

	302	303		305

456	457		459	

	311	312		314

Compare. Write >, < or =.

167 _____176

154 _____156

345 _____354

500 _____500

402 _____455

200 _____ 200

188 _____ 198

459 _____ 449

134 _____ 334

392 _____ 329

LIVEWORKSHEETS

Circle your answer.

371 three hundred and seventeen
three hundred and seventy-one
three hundred and seven

534 five hundred and thirteen
five hundred and forty-three
five hundred and thirty-four

471 four hundred and seventeen
four hundred and seventy-one
four hundred and seventy-nine

105 one hundred and fifty
one hundred and fifteen
one hundred and five

488 four hundred and eighty-eight
four hundred and eighty
four hundred and eighteen

212 two hundred and two
two hundred and twenty-one
two hundred and twelve

LIVEWORKSHEETS

Write the number.

three hundred and eighty-six _____

four hundred and fifty-two _____

sixty- seven _____

three hundred and seventy-nine_____

one hundred and six _____

Write the digital time.

1.

2.

3.

4.

5.

6.

7.

8.

9.

LIVEWORKSHEETS

Odd or even? Write odd or even.

a. 22 _____

b. 23 _____

c. 567 _____

d. 123 _____

e. 1009 _____

f. 48 _____

g. 360 _____

h. 95 _____

i. 71 _____

j.86 _____

Write the correct time.

_____

_____

_____

_____

_____

_____

_____

_____

_____

LIVEWORKSHEETS

Equal Groups Multiplication

MATH MONKS

Fill in the blanks to describe the equal group models. Also, multiply to get the total. One is done for you.

Solved



2 groups of 3

2 × 3 = 6 in total.



___ groups of ___

___ × ___ = ___ in total.

___ groups of ___

___ × ___ = ___ in total.



___ groups of ___

___ × ___ = ___ in total.

___ groups of ___

___ × ___ = ___ in total.

___ groups of ___

___ × ___ = ___ in total.

LIVEWORKSHEETS