Name: _____ Date: _____

Multiplication (equal groups)



Complete the sentences by writing in the correct number for each equal group.

1. Ben has ____ groups of ____ fish.

   ____ x ____ = ____



2. My mom bought ____ groups of ____ apples.

   ____ x ____ = ____

LIVEWORKSHEETS

3. Ashley has ____ groups of ____ stars.

____ x ____ = ____



4. I collected ____ groups of ____ cans.

____ x ____ = ____

5. My brother has ____ groups of ____ pretzels.

____ x ____ = ____

LIVEWORKSHEETS