Angle on a Straight Line

a)

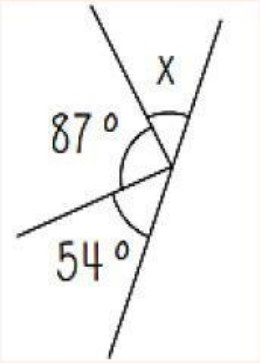

$\angle X =$ _____ °

b)

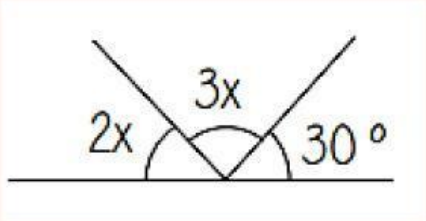

$\angle X =$ _____ °

LIVEWORKSHEETS

Angle at a Point

a)

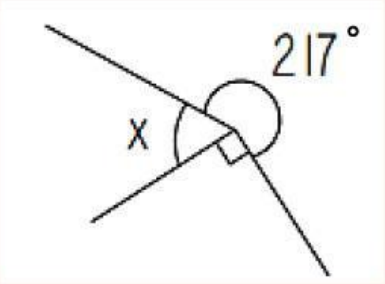

$\angle X =$ _____ °

b)

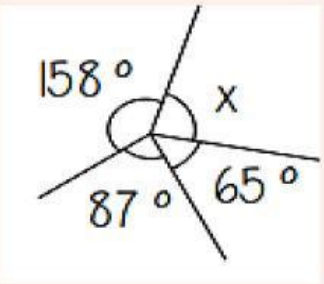

$\angle X =$ _____ °

LIVEWORKSHEETS

Vertically Opposite Angle

a)

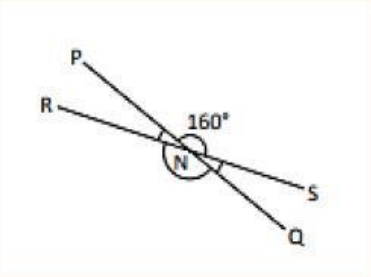

$\angle RNQ =$ _____ °

b)

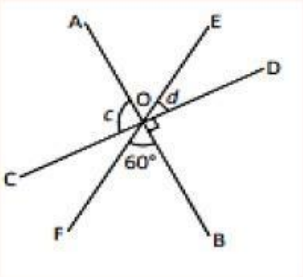

$\angle c =$ _____ °

LIVEWORKSHEETS