Área del cuadrado, rectángulo y triángulo

1. Calcula el área de las siguientes figuras.

Recuerda

$A = L \times L$

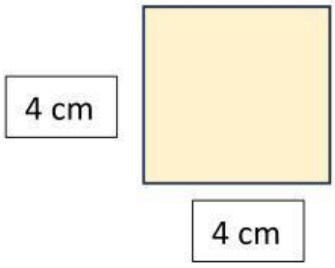

A = _____ cm^2

Recuerda

$A = \frac{b \times a}{2}$

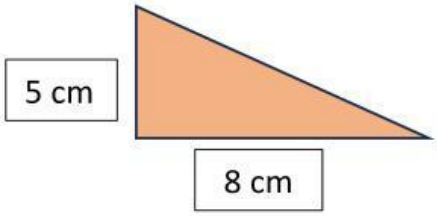

A = _____ cm^2

Recuerda

$A = b \times a$

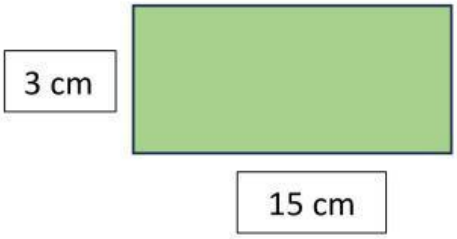

A = _____ cm^2

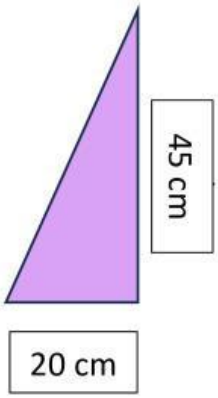

A = _____ cm^2

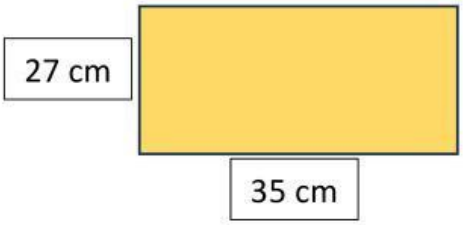

A = _____ cm^2

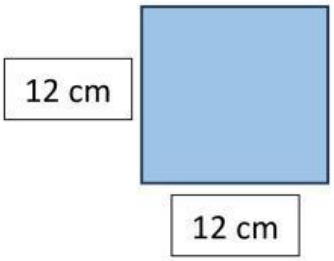

A = _____ cm^2

LIVEWORKSHEETS