Số đếm

Bé đếm số lượng các con vật ở mỗi nhóm và nối với số tương ứng nhé!

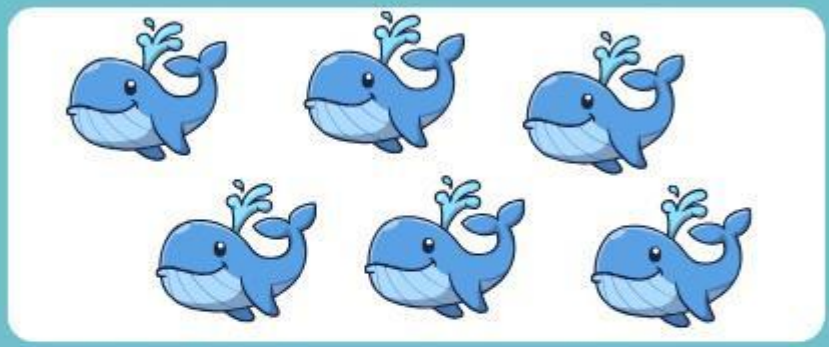

8



6



10



7



9

LIVEWORKSHEETS