MARIEPHITHAK PHANGKHON SCHOOL

SEMESTER 2 FINAL EXAMINATION FOR 2024/25

**MATHEMATICS KINDEGARTEN ELCP K2**

**NAME:** _____ **NUMBER**_____

1. Write the numbers.

| | | |
|---|---|---|
| 1 | 2 | 3 |
| 4 | 5 | 6 |
| 7 | 8 | 9 |

2.Count and write the numbers.

= 3

= ☐





= ☐

3. Count and link with the numbers.

| | |
|---|---|
|  | 2 |
| 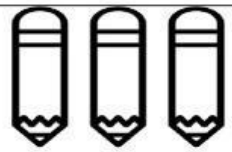 | 7 |
|  | 3 |
|  | 5 |

4. Find

4 + 6 = ☐

5. Find 9 - 4 = ☐

<<<<<<<<<<<<<<<<<<< Good Luck ! >>>>>>>>>>>>>>>>>>>

LIVEWORKSHEETS