بلوک اعداد

پایه دوم

عزیزکم بلوک ها را باهم جمع کن و بصورت عدد بنویس.



۱

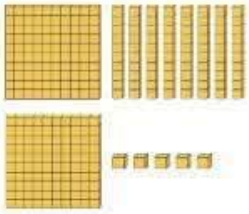

۲

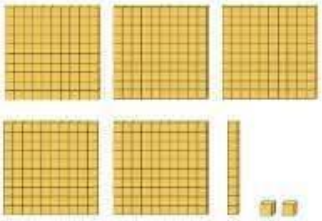

۳



۴

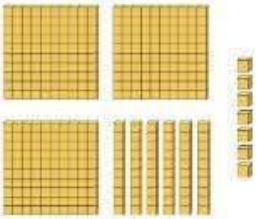

۵



۶

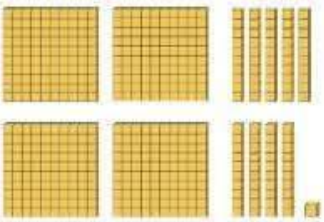

۷



۸



LIVEWORKSHEETS