Observa con atención el número que aparece al lado izquierdo. Selecciona tantos elementos sean necesarios para representar cada número.

2



1



5



3



4



LIVEWORKSHEETS

Cuenta los elementos que aparecen en cada recuadro, señala el número que representa.



2	3	1

2	5	4

1	2	3



5	4	3

4	2	3

5	2	1

LIVEWORKSHEETS

Cuenta los elementos que aparecen en cada recuadro, señala el número que representa.

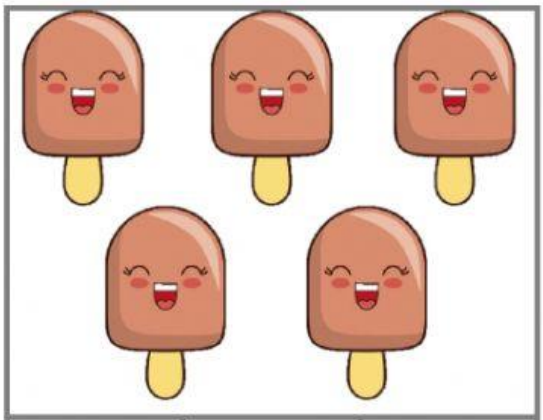

3	2	5

3	2	4

2	4	3

4	1	3



1	2	3



3	2	1

LIVEWORKSHEETS