Nama :

Kelas :

SUDUT BERPELURUS

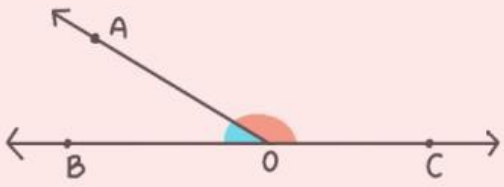

$\angle BOA + \angle AOC = 180^{\circ}$

Dua sudut dikatakan saling berpelurus apabila jumlahnya adalah 180 derajat.

LATIHAN

Carilah nilai sudut yang belum diketahui!

1

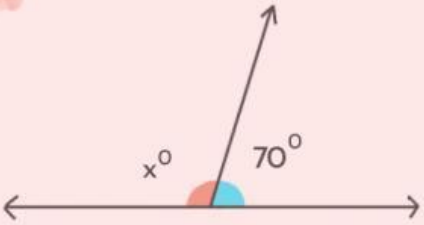

x = _____

2

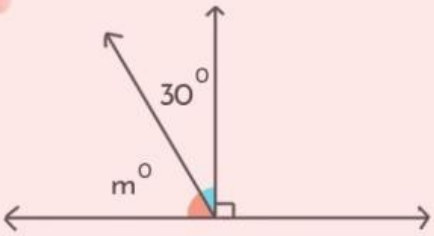

m = _____

3

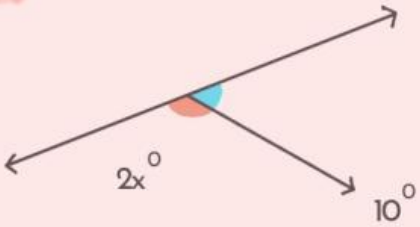

x = _____

4

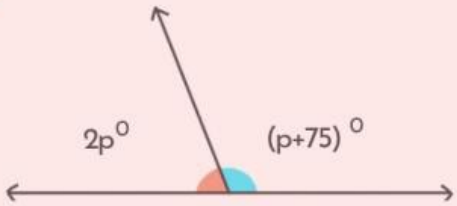

p = _____

LIVEWORKSHEETS