Прізвище та ім'я_____ Клас_____ Дата_____

Сума кутів трикутника

Знайдіть невідомі кути трикутника

1)

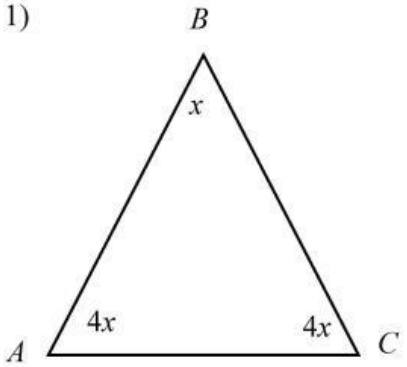

∠A=_____ ∠B=_____ ∠C=____

2)

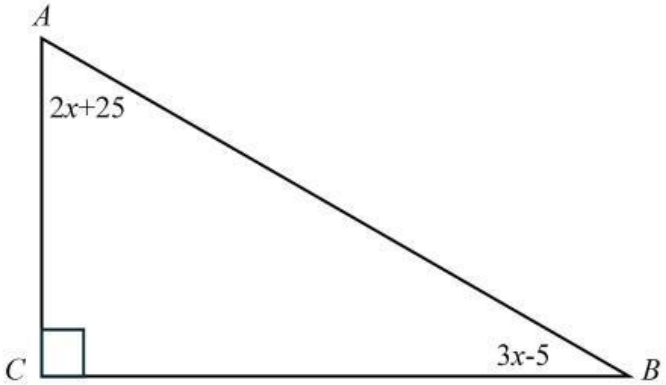

∠A=_____ ∠B=_____ ∠C=_____

3)

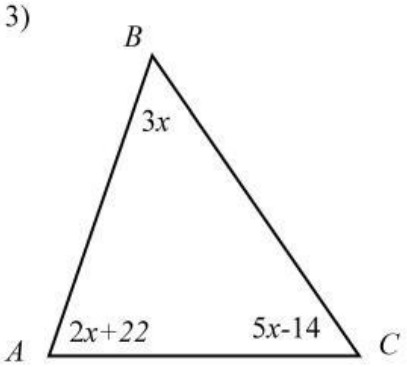

∠A=_____ ∠B=_____ ∠C=_____

4)

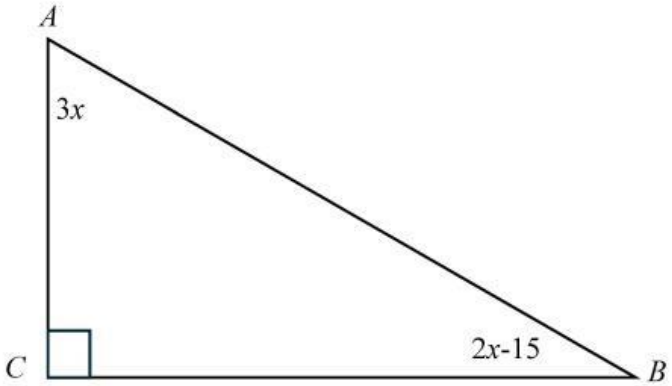

∠A=_____ ∠B=_____ ∠C=_____

5)

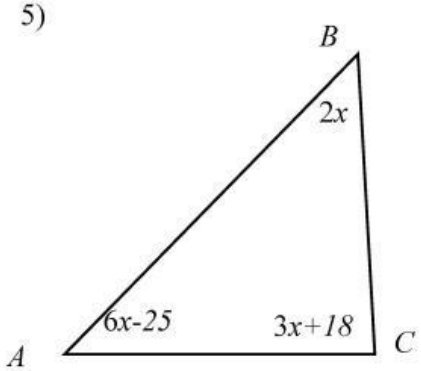

∠A=_____ ∠B=_____ ∠C=_____

6)

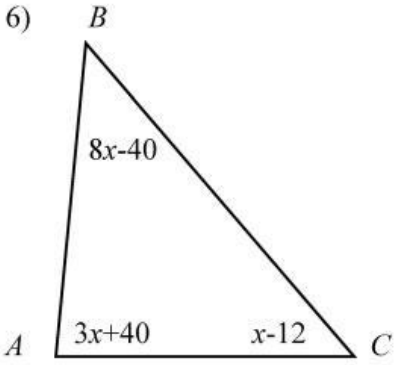

∠A=_____ ∠B=_____ ∠C=_____

LIVEWORKSHEETS