Name: ……..……..……Nickname……..…… Class: …..…. No: ..……

Assignment 7: Create pie chart

Complete the table and draw a pie chart to show the data. ◎ ☺ ○

$$Degrees = \frac{percentgae}{100} \times 360°$$

1. The pie chart shows Sara's monthly expenses

Items	**Percentage of expenses**	**Degrees**
Food	25%	90°
Education of children	20%	
Clothing	10%	36°
Household expenses	15%	54°
Savings	30%	
Total		

From 1, Data in a table shows as a pie chart as follows: Choose the correct pie chart.

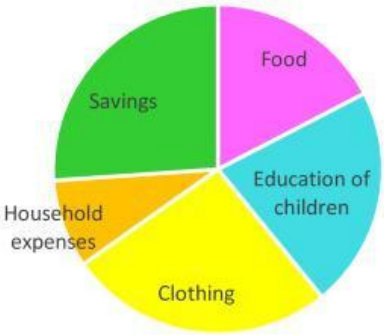

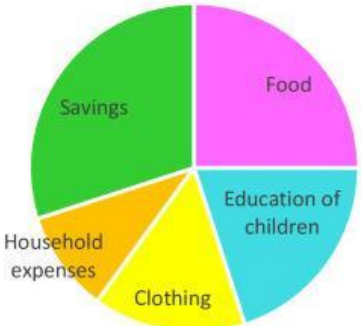

LIVEWORKSHEETS

2. The pie chart shows the number of students favorite sport.

Favorite pet	Percentage of students	Degrees
Dog	40%	
Cat	35%	
Fish	10%	
Tiger	15%	
Total		

From 2, Data in a table shows as a pie chart as follows: Choose the correct pie chart.

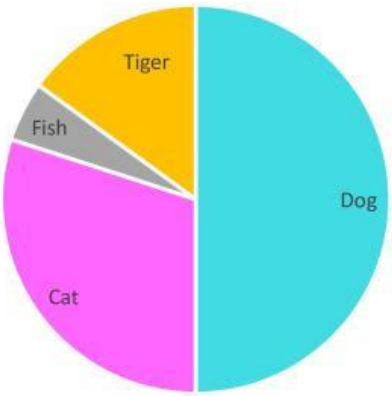

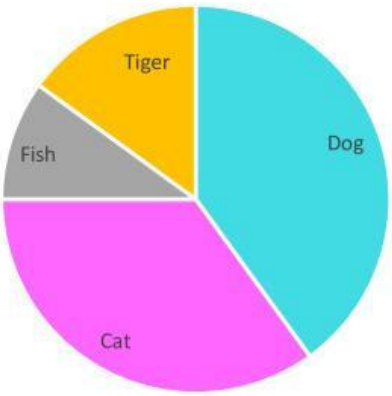

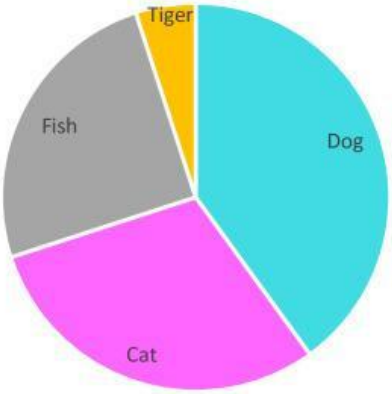

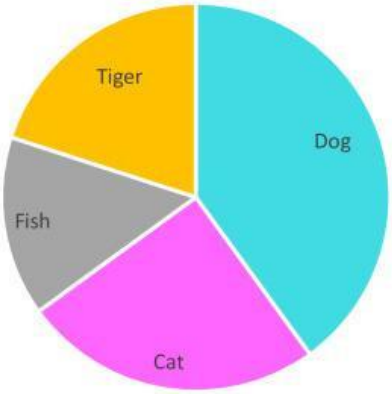

LIVEWORKSHEETS

3. The pie chart shows the number of students favorite Game online. From the survey, there were a <u>total of 200 students</u> playing online games.

Game online	Percentage of students	Number of students	Degrees
ROV	35%		
Free Fire	30%		
Arena Breakout	20%		
Minecraft	5%		
PUBG	10%		
<u>Total</u>			

From 3, Data in a table shows as a pie chart as follows: Choose the correct pie chart.

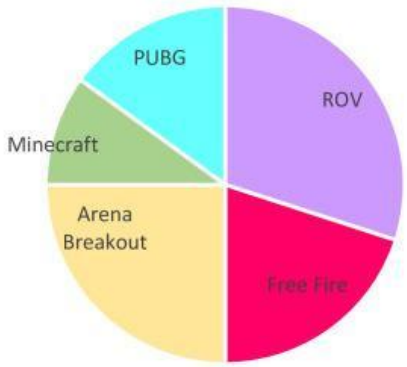

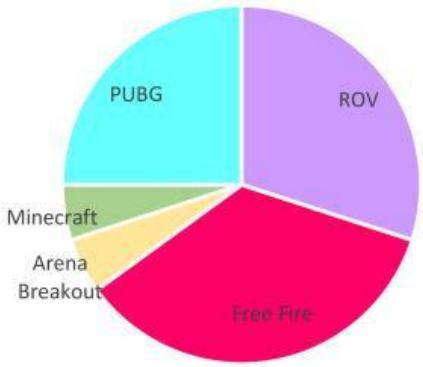

LIVEWORKSHEETS