Test 2C

PSR Filling the Gaps - Paper 2

Comprehension

1. A tray of 10 eggs costs $2.20. What is the cost of 4 eggs?

2. Farid is standing at a point marked **'X'** in the figure below. He is facing Masjid Jame'. Which place is South-West to where he is facing?

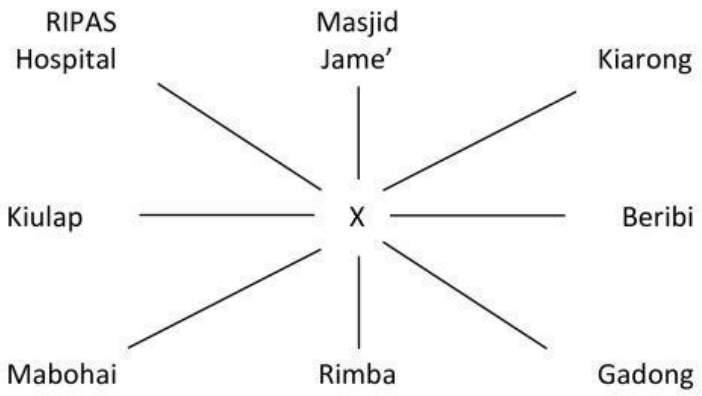

3.

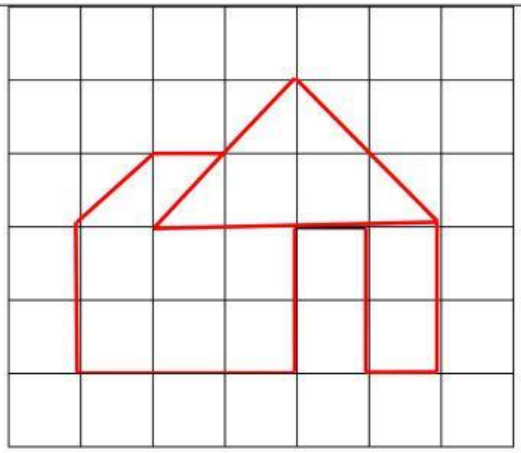

If one small square represents 1 cm square, what is the area of the shape?

4.

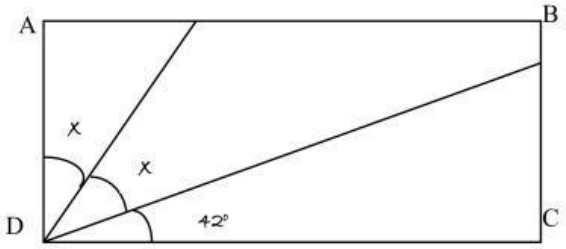

What is the value of x ?

LIVEWORKSHEETS