LKPD

MATEMATIKA

KELAS : I

NAMA :

KELAS :

OLEH : AISYAH NOOR AINI

LIVEWORKSHEETS

1 SATU



LIVEWORKSHEETS

2 DUA



LIVEWORKSHEETS

3 TIGA

LIVEWORKSHEETS

4 EMPAT

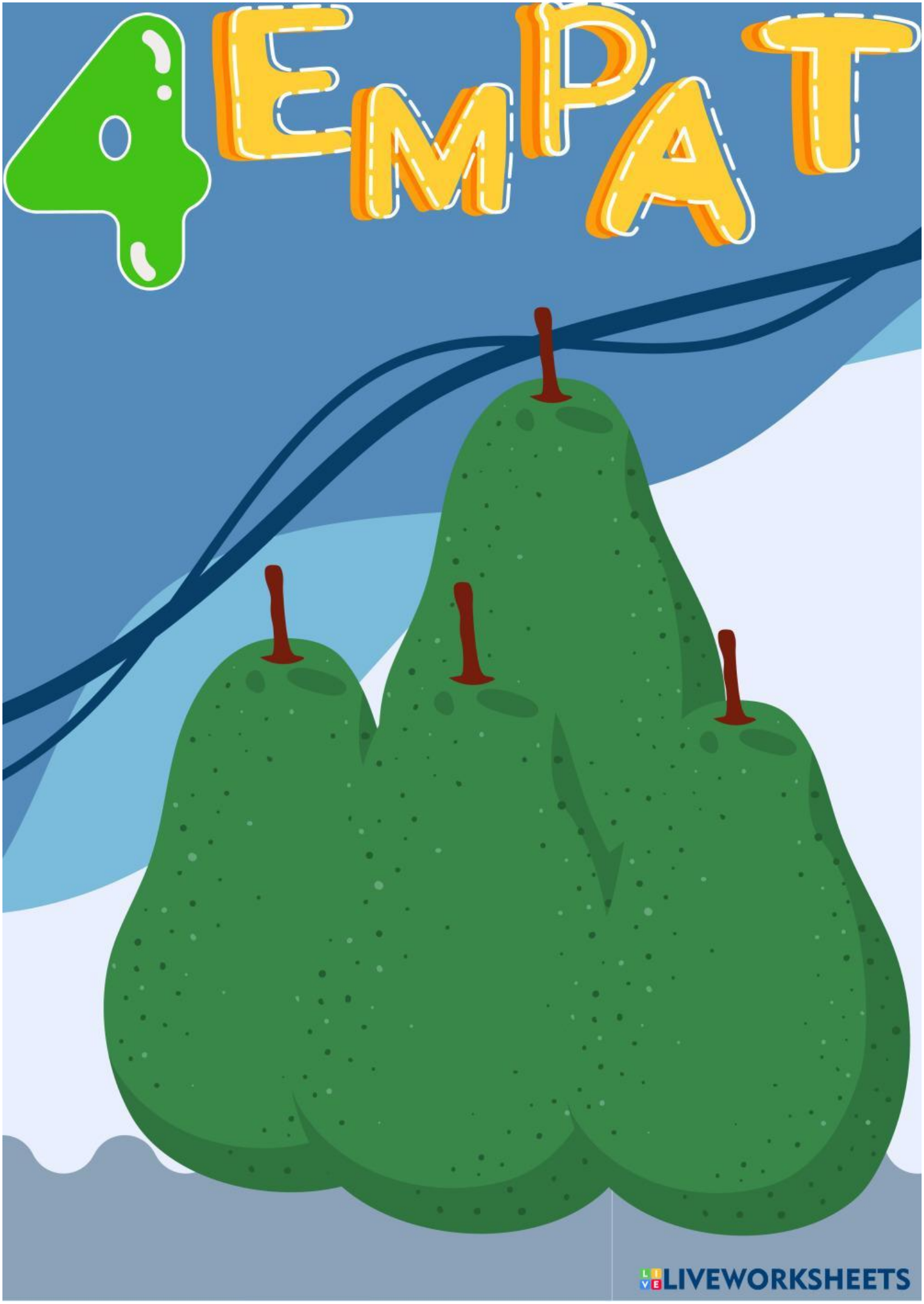

LIVEWORKSHEETS

5 LIMA

LIVEWORKSHEETS

6 ENAM



LIVEWORKSHEETS

7 Tujuh

LIVEWORKSHEETS

8 DELAPAN

LIVEWORKSHEETS

9 SEMBILAN

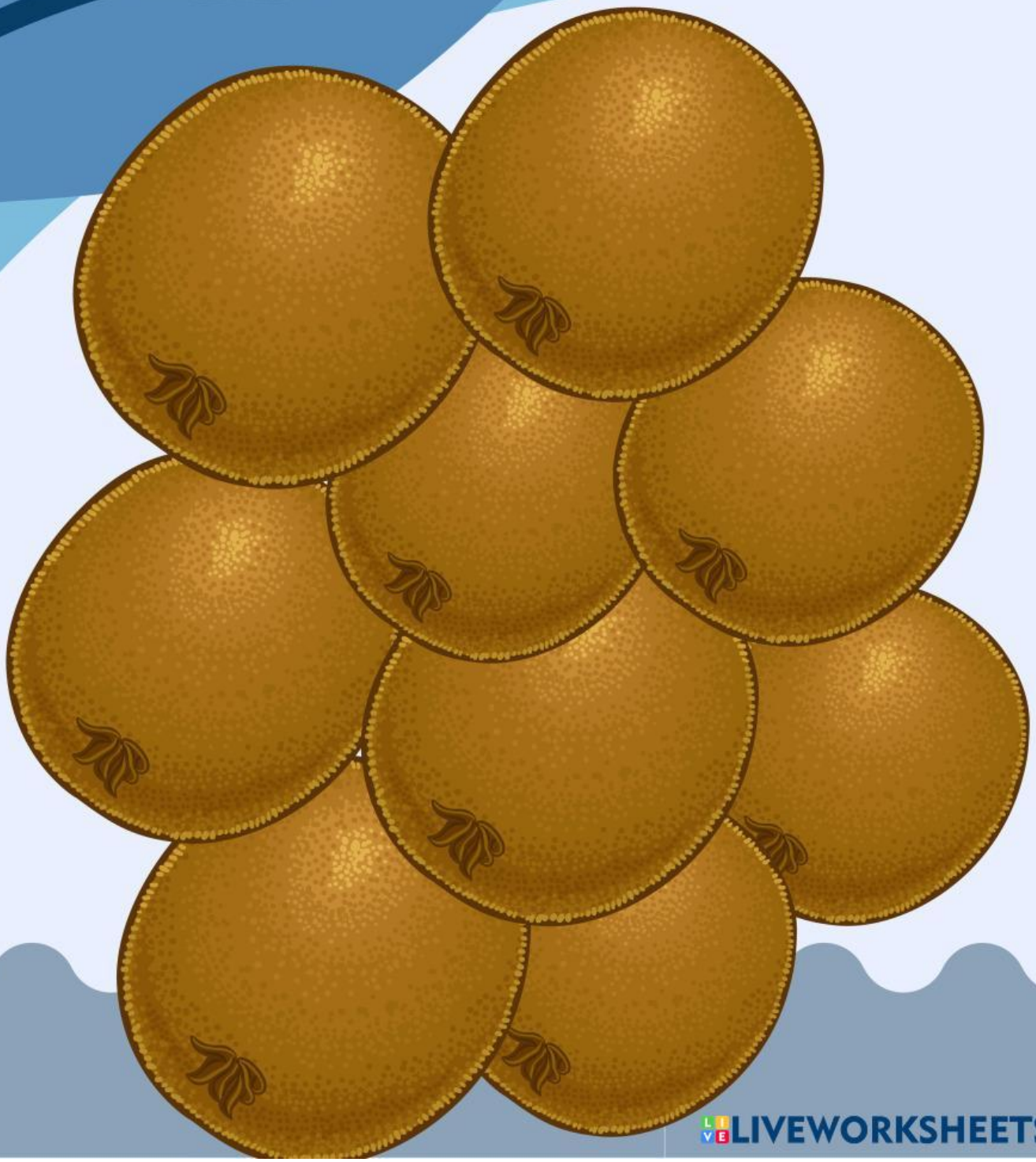

LIVEWORKSHEETS

10 SEPULUH

LIVEWORKSHEETS

Nama : .....

Tanggal : .....

Hitung dan Jumlahkanlah Bunga di bawah ini

2 + 3 = ...

3 + 3 = ...



2 + 2 = ...

4 + 3 = ...

LIVEWORKSHEETS

Nama : ..... Tanggal : .....

MARI BERHITUNG

Lingkarilah jumlah yang sesuai dengan gambar

5 3 2

4 6 2

1 3 6

2 6 4

3 8 5

1 3 6

LIVEWORKSHEETS

Nama : ..... Tanggal : .....

MENGHITUNG BUAH

Tuliskan angka yang sesuai dengan jumlah buah !





LIVEWORKSHEETS

Nama : .....

Kelas : .....

Belajar Menghitung

Berikan jawaban yang benar dari penjumlahan atau pengurangan berikut ! Selamat mengerjakan !



3 + 2 = _____



6 - 2 = _____

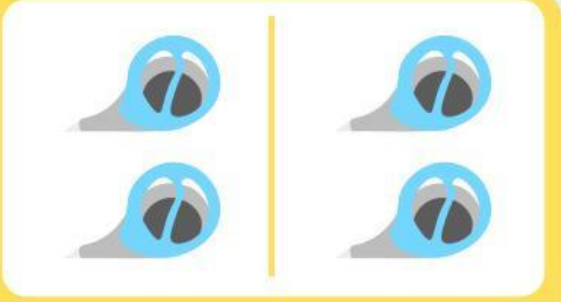

2 + 2 = _____

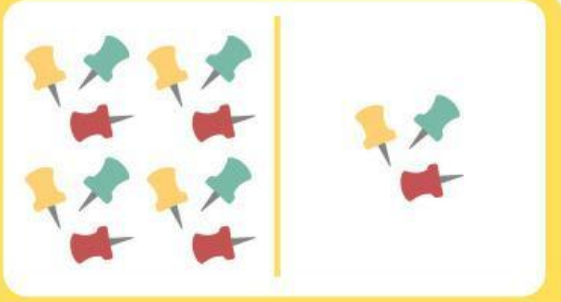

4 - 1 = _____



4 + 2 = _____

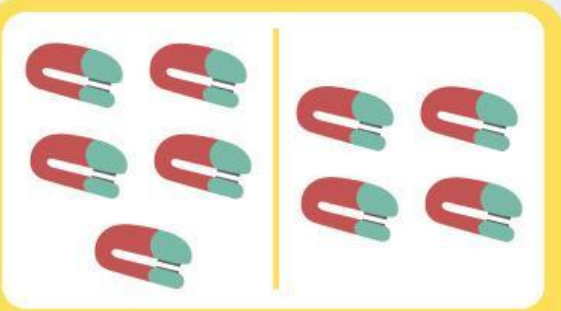

5 - 4 = _____

LIVEWORKSHEETS