Name:_____

CCSS 2.OA.2 Fluently add and subtract within 20 using mental strategies,.....

Count Back to Subtract

Directions: Use the number line below to count back to subtract. Show you work on the number line.

1) 14 - 5 = ____

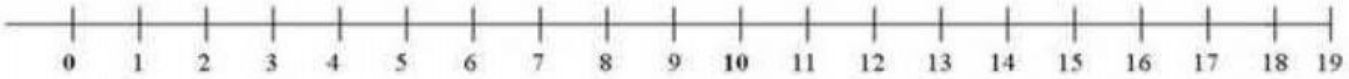

2) 9 - 3 = ____

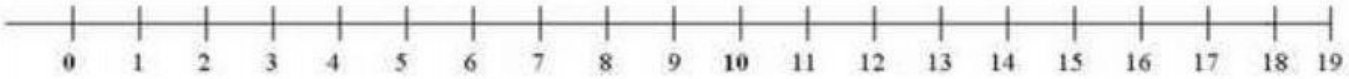

3) 12 - 8 = ____

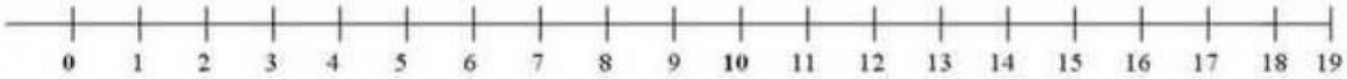

4) 18 - 9 = ____

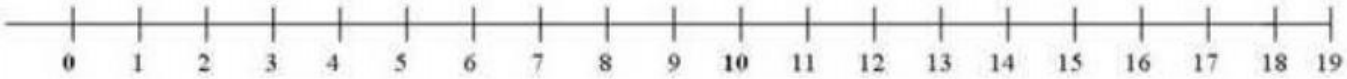

5) 7 - 4 = ____

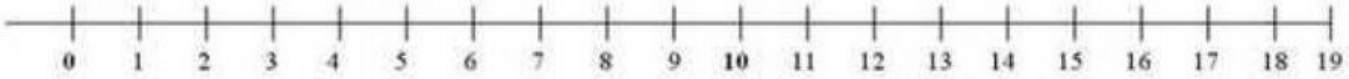

____ I double checked my work.

LIVEWORKSHEETS