menghitung tumbuhan

ayo menghitung dengan memilih salah satu jawaban



3 2 4 1

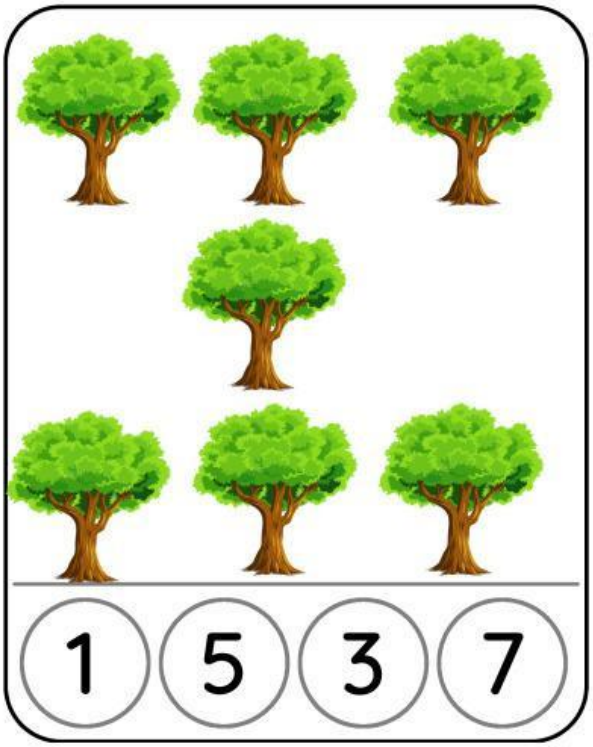

1 5 3 7



7 8 9 6



5 4 6 9

LIVEWORKSHEETS

Gambarlah garis untuk menghubungkan angka dengan jumlah bunga yang tepat.

1

2

3

4

5

LIVEWORKSHEETS