A-grupa ***Trijstūra zīmēšana***

Norādi ar cipari trijstūra numuru, kas atbilst dotajai informācijai:

1) $A = 60^{\circ}$, $b = 10cm$
$c = 8cm$, $a = x$

Atbilst trijstūris Nr. ____

2) $B = 30^{\circ}$, $b = x$
$c = 4.4cm$, $a = 3.8cm$

Atbilst trijstūris Nr. ____

3) $C = 45^{\circ}$, $b = 4.6m$
$c = x$, $a = 5.1m$

Atbilst trijstūris Nr. ____

4) $P = 78^{\circ}$, $q = 7km$
$r = 4km$, $p = x$

Atbilst trijstūris Nr. ____

5) $X = 52^{\circ}$, $y = 16.3$
$z = 22.1$, $x = a$

Atbilst trijstūris Nr. ____

6) $a = 8.7cm$, $b = 11.1cm$
$c = 13.2cm$, $A = \theta$

Atbilst trijstūris Nr. ____

7) $a = 17m$, $b = 14m$
$c = 11m$, $B = \theta$

Atbilst trijstūris Nr. ____

8) $p = 5.32mm$, $q = 4.3mm$
$r = 6.71mm$, $R = \theta$

Atbilst trijstūris Nr. ____

9) $x = 7.2mm$, $y = 5.4mm$
$z = 9.8mm$, $Z = \theta$

Atbilst trijstūris Nr. ____

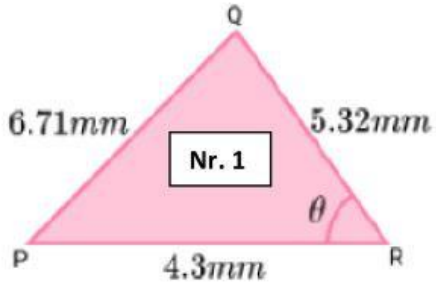

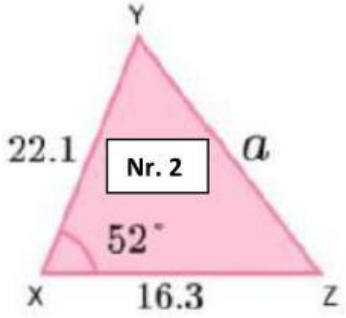

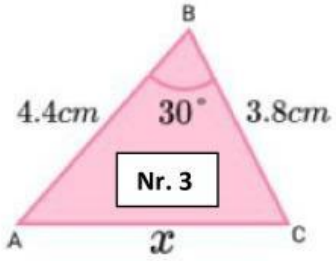

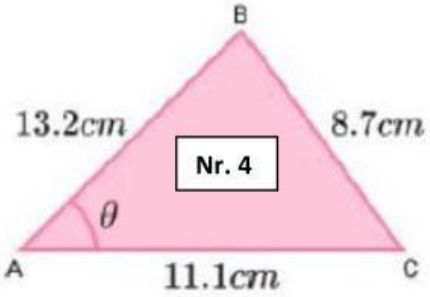

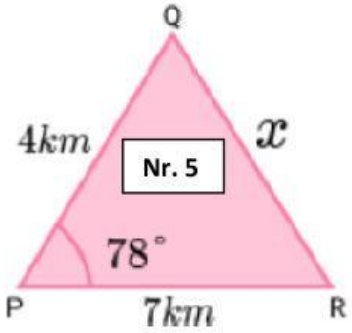

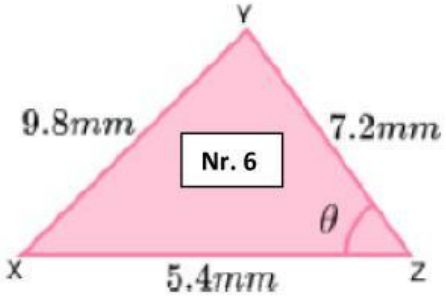

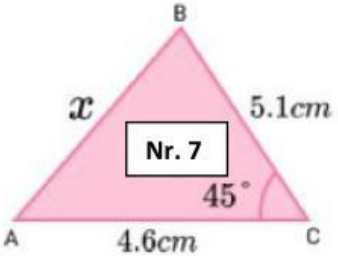

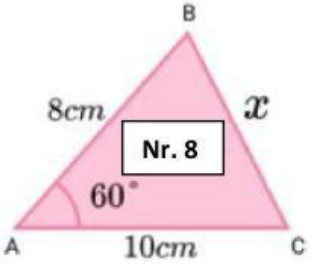

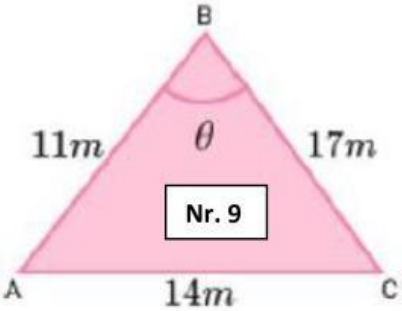

LIVEWORKSHEETS