Nama : Kelas :

# MATEMATIKA

## Ceklislah jawaban yang benar !

1. Manakah Simbol Pengurangan...

2. Manakah Simbol Perkalian...

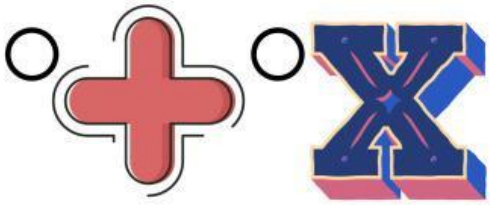

3. Manakah Simbol Penjumlahan...

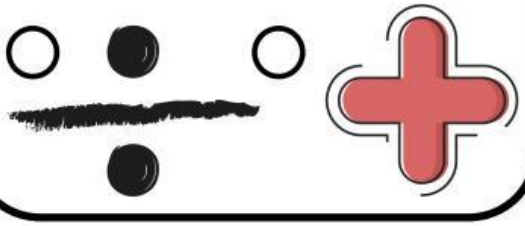

4. Manakah Simbol Sama dengan...

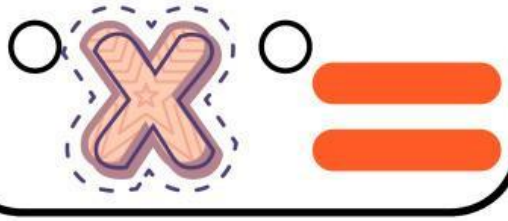

5. Manakah Hasil Dari Perkalian 2 x 5?

10 12

6. Manakah Hasil dari Penjumlahan 20 + 5 ?

20 25

7. Manakah Hasil Dari Pengurangan 20 -15 ?...

15 5

8. Manakah Hasil dari 5 x 3 ?

7 15

LIVEWORKSHEETS