B. Tuliskan empat asas elemen sistem robotik.

ELEMEN SISTEM ROBOTIK

1.

2.

3.

4.

LIVEWORKSHEETS

C. Isi tempat kosong dengan elemen robotik yang betul.

Buku Teks m.s. 18

SP 6.5.1

TP 1

Pautan Video

I-THINK

Pergerakan | Kuasa | Sensor | Kawalan

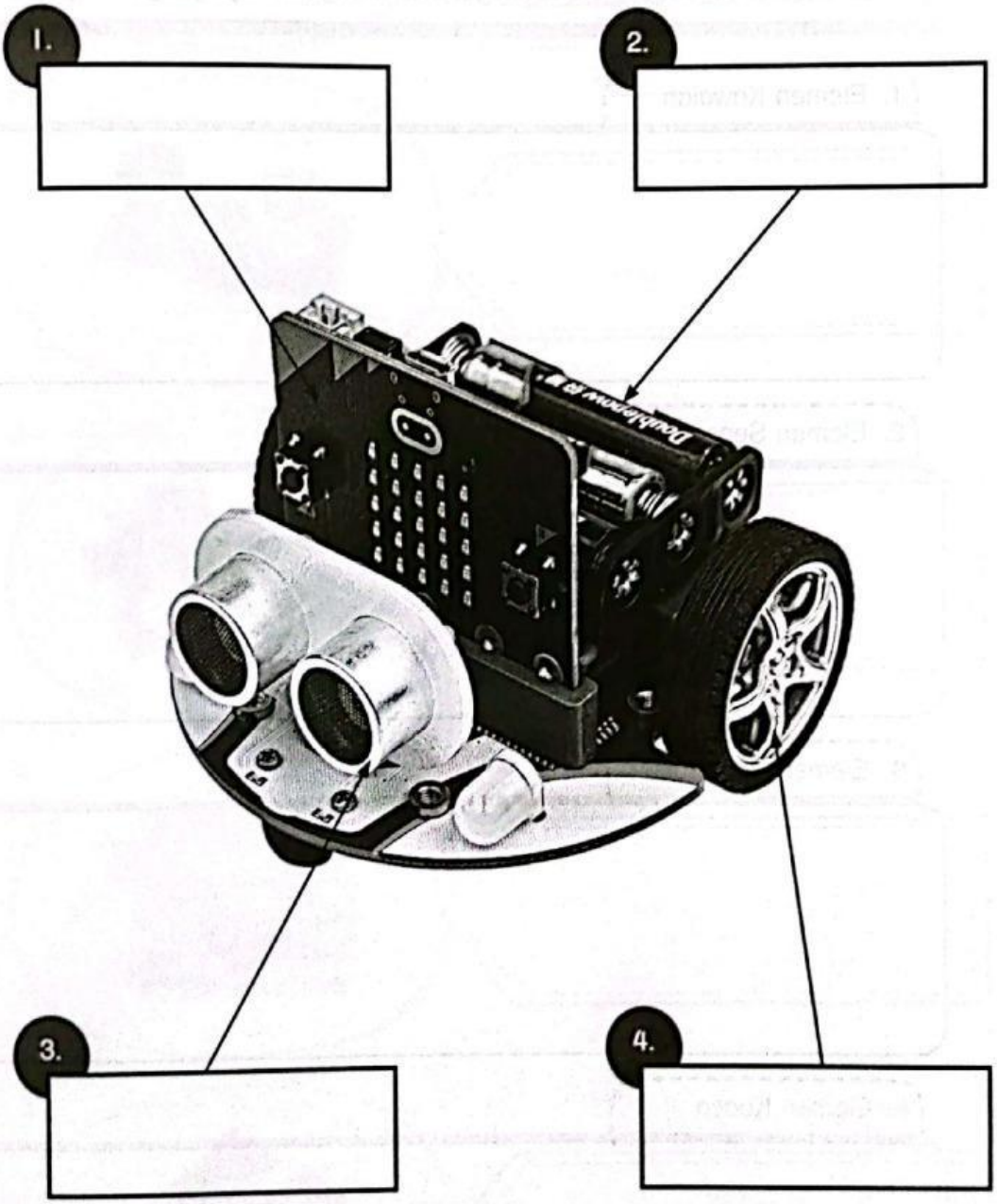

Pautan Video

LIVEWORKSHEETS

D. Terangkan fungsi perkakasan di bawah ini.

Buku Teks m.s. 25 – 26

SP 6.5.1

TP 1

Pautan Video

1.



2.



3.

4.



5.

Pautan Video

LIVEWORKSHEETS CamScanner