Nama: Kelas:

Bangun Datar

Isikan jawaban yang benar pada kolom yang tersedia!



Nama Bangun Datar :

Jumlah Sisi : Jumlah Sudut : Jumlah Diagonal :

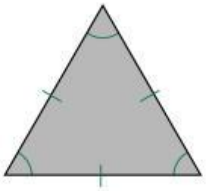

Nama Bangun Datar :

Jumlah Sisi : Jumlah Sudut : Jumlah Diagonal :

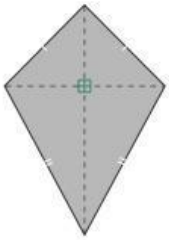

Nama Bangun Datar :

Jumlah Sisi : Jumlah Sudut : Jumlah Diagonal :

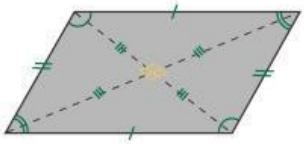

Nama Bangun Datar :

Jumlah Sisi : Jumlah Sudut : Jumlah Diagonal :

LIVEWORKSHEETS