March 9th, 2021

Social Studies

Mapping Skills

Directions: Study the map below. Use the map to help you answer the questions on the blank map.

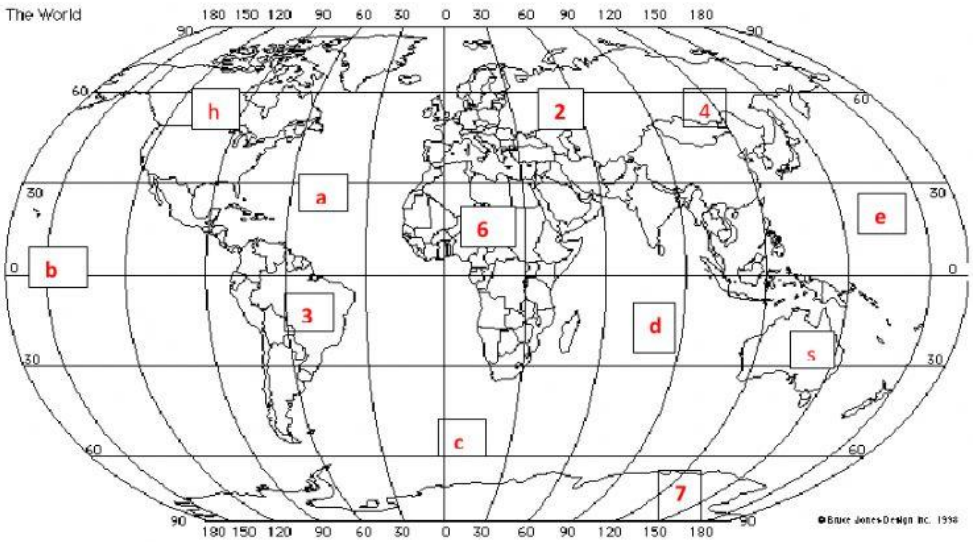

Write the number or letter on the line next to the correct continent, ocean or imaginary line.

1. Equator	2. North America
3. Europe	4. Pacific Ocean
5. Atlantic Ocean	6. South America
7. Prime Meridian	8. Africa
9. Australia	10. Asia

LIVEWORKSHEETS

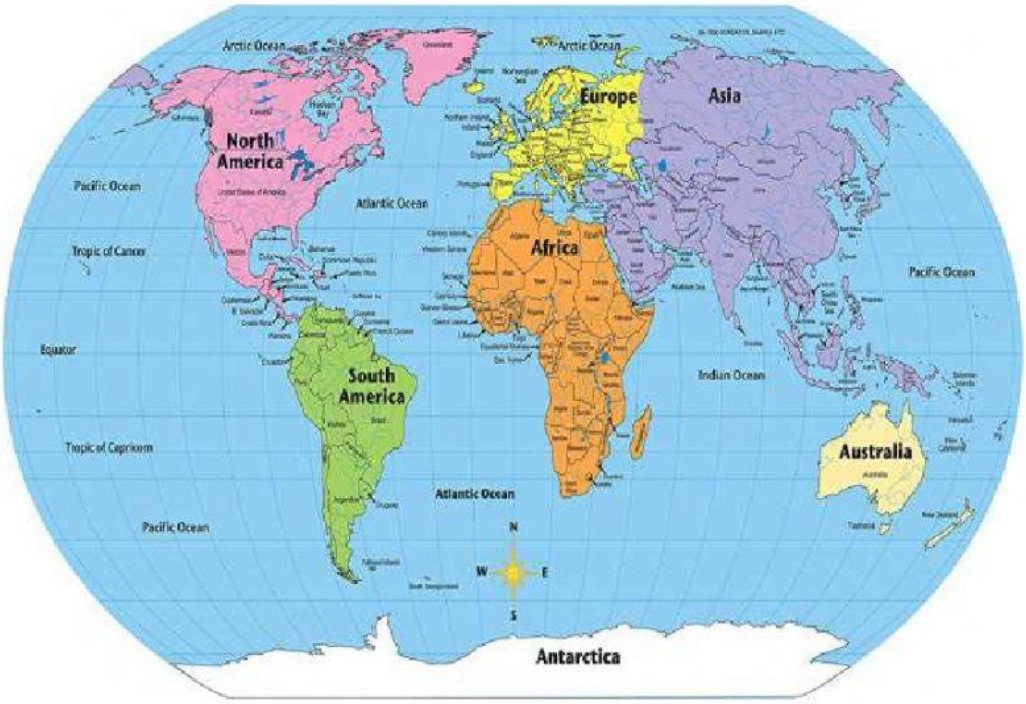



Directions: Use your compass and the map of the world above to help answer the following questions.

13. You are in South America and travelling to Asia. Which direction will you travel?

14. You are in Australia and travelling to South America. Which direction will you travel?

15. You are in Antarctica and travelling to North America. Which direction will you travel?

LIVEWORKSHEETS

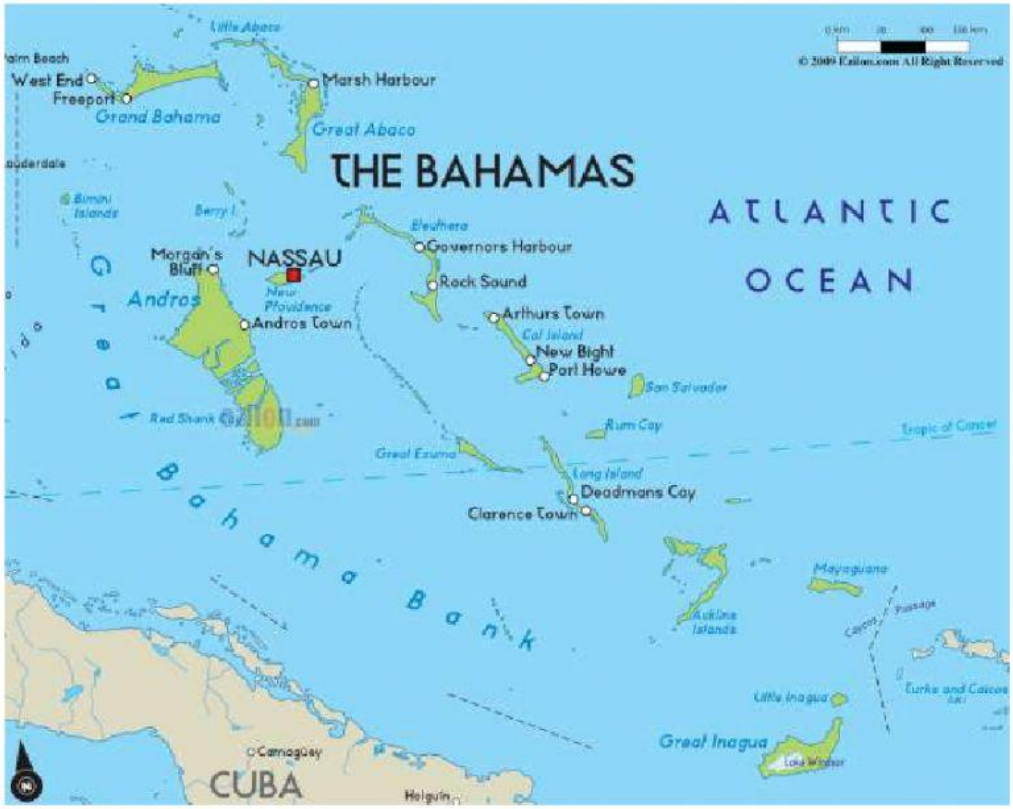



Directions: Use your compass and the map of The Bahamas above to help answer the following questions.

16. Name the fishing ground that is west of Andros? (Clue the name of the Bank)

17. If you are in San Salvador and travelling to Grand Bahama, in which direction will you travel?

18. If you are in Exuma and travel to New Providence, in which direction will you travel?

19. You are on Andros Island and travel to Rum Cay. In which direction will you travel?

20. Which two islands does the Topic of Cancer pass through?

LIVEWORKSHEETS