BOOST

Name_____ ID: 1

Inequalities Review

Date_____ Period____

Solve each inequality and graph its solution.

1) $b - 2 \leq 1$

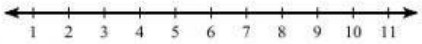

2) $14 < \frac{v}{19}$

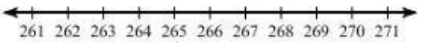

3) $-16r < -48$

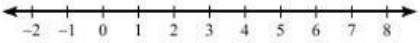

4) $2x \leq 22$

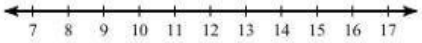

5) $-27 > r - 7$



6) $\frac{v}{19} \geq -5$

LIVEWORKSHEETS

7) $5x + 5 > 50$

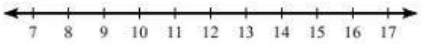

8) $-46 \leq 10 - 8x$



9) $-2 \geq \frac{n+1}{5}$

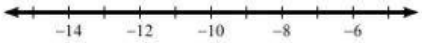

10) $8 + \frac{p}{4} \leq 9$

11) $\frac{a-9}{4} \leq -2$

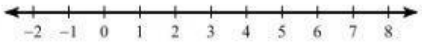

12) $-4 + 9b > -31$

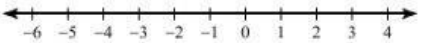

13) $5(3 - 6n) < -105$

14) $-3(-3x + 3) > -81$

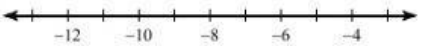

LIVEWORKSHEETS