Math 2 Name_____ ID: 1

Angles Inside and Outside of a Circle

Date_____

© 2012 Kuta Software LLC. All rights reserved.

Find the measure of the arc or angle indicated. Assume that lines which appear tangent are tangent.

1)

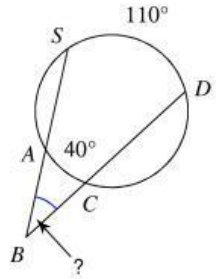

2)

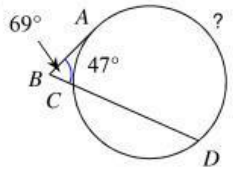

3)

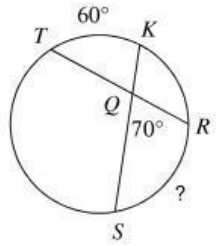

4)

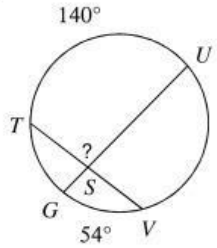

5)

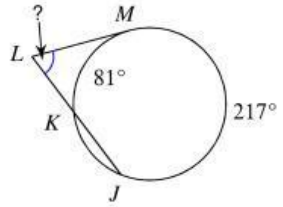

6)

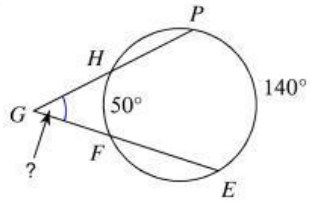

7)

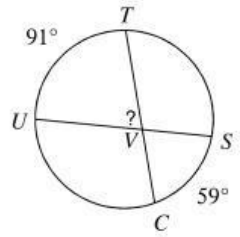

8)

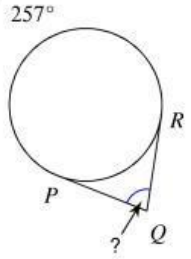

9)

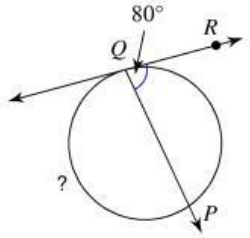

10)

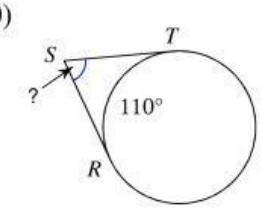

© 2012 Kuta Software LLC. All rights reserved. Made with Infinite Geometry.

LIVEWORKSHEETS

11) Find $m\widehat{JK}$

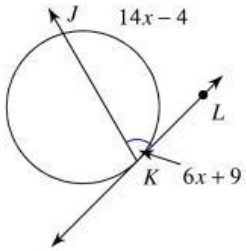

12) Find $m\angle KLM$

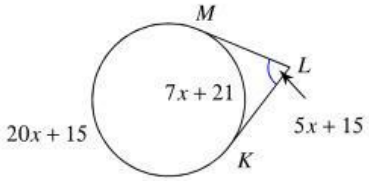

13) Find $m\angle RSU$

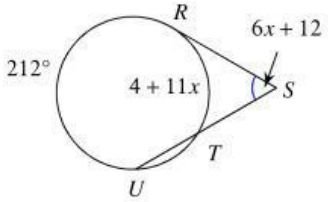

14) Find $m\angle FEG$

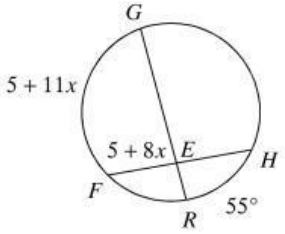

15) Find $m\angle SUP$

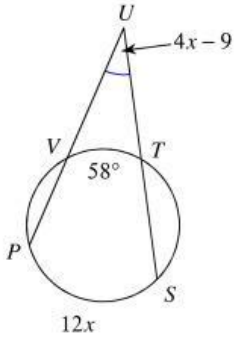

16) Find $m\angle LKM$

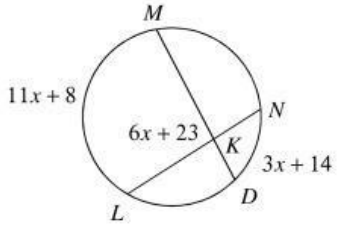

17) Find $m\angle MLK$

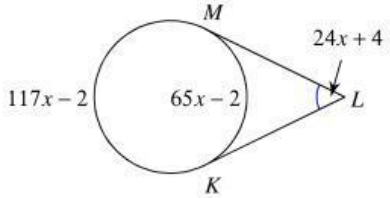

18) Find $m\angle JKM$

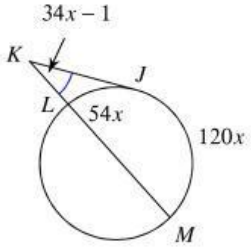

19) Find $m\angle JLS$

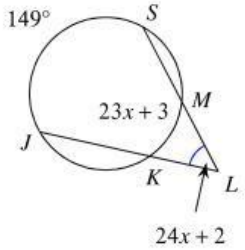

20) Find $m\widehat{DE}$

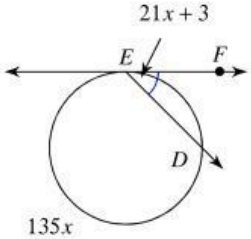

© 2012 Kuta Software LLC. All rights reserved. Made with Infinite Geometry.

LIVEWORKSHEETS