Maths-Whizz
Teachers' Resource

Name: . . . . . Class: . . . . . .

Measures

Read the time shown on the digital display and draw the hands to show the time on the analogue clock.

Q1 **7:00**

Q2 **4:05**

Q3 **2:20**

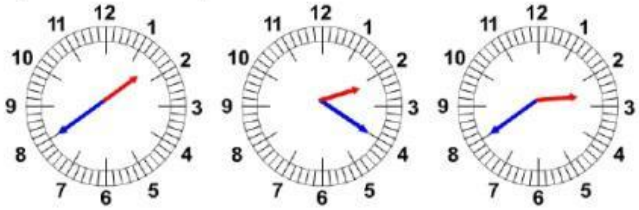

Q4 **10:14**

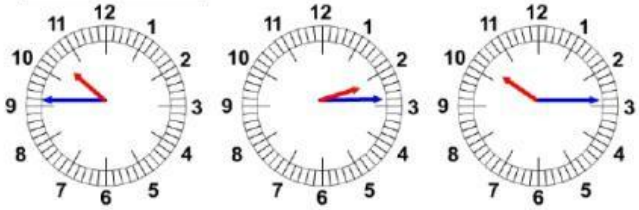

Q5 **3:41**

Whizz Education © 2014

LIVEWORKSHEETS

Maths-Whizz
Teachers' Resource

Name: . . . . . Class: . . . . . .

Measures

Read the time shown on the digital display and draw the hands to show the time on the analogue clock.

Q6 **11:29**

Q7 **8:17**

Q8 **1:24**

Q9 **5:58**

Whizz Education © 2014

LIVEWORKSHEETS

Maths-Whizz
Teachers' Resource

Name: . . . . . Class: . . . . . .

Measures

Write the time on each analogue clock as a digital display and circle to say if it is am or pm.

Q1

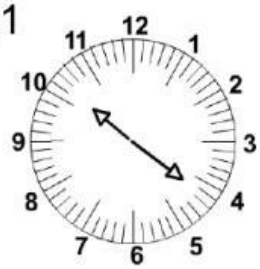

evening am/pm

Q2



early morning am/pm

Q3

afternoon am/pm

Q4

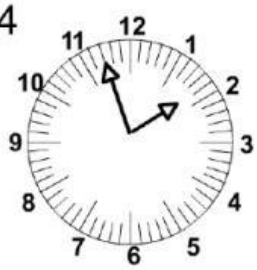

early morning am/pm

Q5

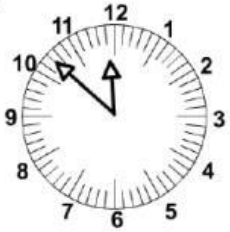

almost midday am/pm

Q6



afternoon am/pm

Q7



early morning am/pm

Q8

almost midnight am/pm

Whizz Education © 2014 LIVEWORKSHEETS

Maths-Whizz
Teachers' Resource

Name: . . . . . Class: . . . . . .

Measures

Write the time on each analogue clock as a digital display and circle to say if it is am or pm.

Q9

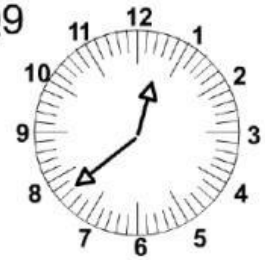

lunch time **am/pm**

Q10



morning **am/pm**

Whizz Education © 2014 LIVEWORKSHEETS

Maths-Whizz
Teachers' Resource

Name: . . . . . Class: . . . . . .

Measures

Read the measurement on the scales. How many kilograms (kg) and grams (g) are shown?

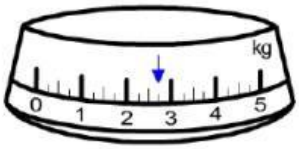

2 kg 750 g

Read the measurement and fill in the boxes.

Q1

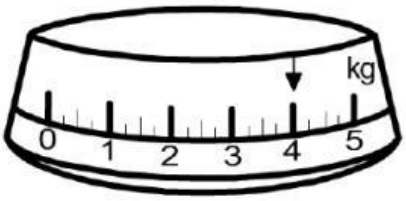

kg g

Q2

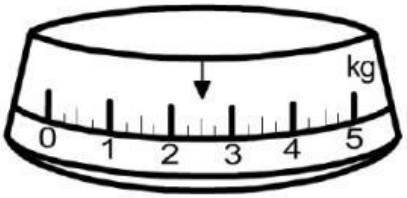

kg g

Q3

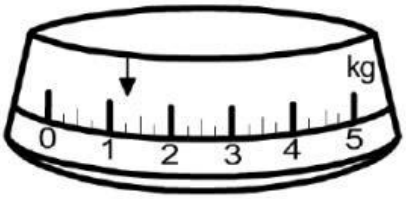

kg g

Q4

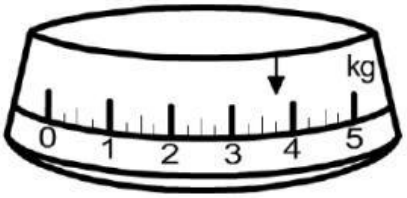

kg g

Q5

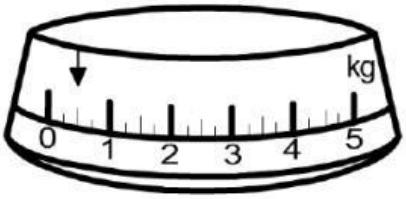

kg g

Q6

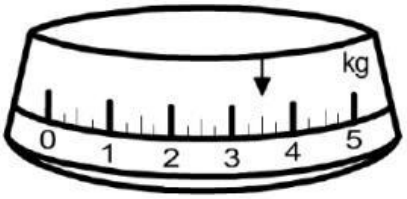

kg g

Q7

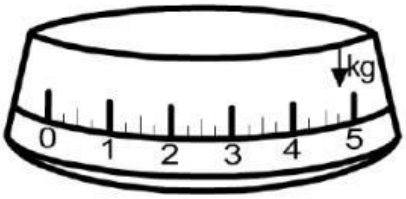

kg g

Q8

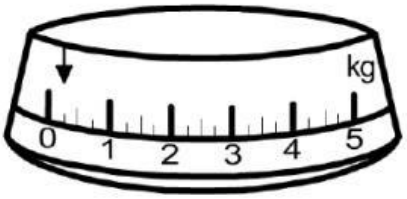

kg g

Whizz Education © 2014

LIVEWORKSHEETS

Maths-Whizz
Teachers' Resource

Name: . . . . . Class: . . . . . .

Measures

Read the measurement and fill in the boxes.

Q9

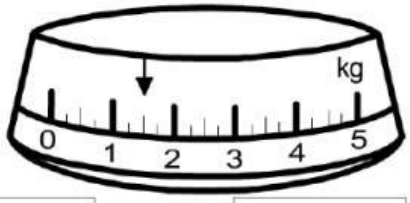

kg g

Q10

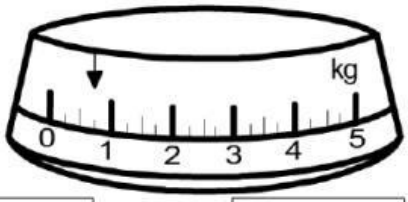

kg g

Whizz Education © 2014
LIVEWORKSHEETS

Maths-Whizz
Teachers' Resource

Name: . . . . . Class: . . . . . .

Measures

Wriite these lengths in millimetres (mm).

Q1

2 cm = ☐ mm

Q2

3m = ☐ mm

Q3

10 cm= ☐ mm

Q4

14 cm= ☐ mm

Q5

5.5cm= ☐ mm

Q6

12 cm= ☐ mm

Write these lengths in centimetres (cm).

Q7

10mm = ☐ cm

Q8

20mm = ☐ cm

Q9

300mm = ☐ cm

Q10

25mm = ☐ cm

Q11

5 mm = ☐ cm

Q12

1 mm = ☐ cm

Whizz Education © 2014

LIVEWORKSHEETS

Maths-Whizz
Teachers' Resource

Name: . . . . . Class: . . . . . .

Measures

Write these weights in grams (g).

Q1

1 kg = ☐ g

Q2

3 kg = ☐ g

Q3

5 kg = ☐ g

Q4

One half of 1 kg = ☐ g

Q5

One quarter of 1 kg = ☐ g

Q6

Three quarters of 1 kg = ☐ g

Write these weights in kilograms (kg).

Q7

2000 g = ☐ Kg

Q8

4000 g = ☐ Kg

Q9

10000 g = ☐ Kg

Q10

1500 g = ☐ Kg

Q11

76500 g = ☐ Kg

Q12

80000 g = ☐ Kg

Whizz Education © 2014

LIVEWORKSHEETS

Maths-Whizz
Teachers' Resource

Name: . . . . . Class: . . . . . .

Measures

Write these amounts in millilitres (ml).

Q1

1 litre = ☐ ml

Q2

2 litre = ☐ ml

Q3

7 litre = ☐ ml

Q4

One quarter of 1 litre = ☐ ml

Q5

Three quarters of 1 litre = ☐ ml

Q6

One tenth of 1 litre = ☐ ml

Write these amounts in litres (l).

Q7

3 000 ml = ☐ ℓ

Q8

5 000 ml = ☐ ℓ

Q9

12 000 ml = ☐ ℓ

Q10

1 100 ml = ☐ ℓ

Q11

65 00 ml = ☐ ℓ

Q12

94 000 ml = ☐ ℓ

Whizz Education © 2014

LIVEWORKSHEETS

Maths-Whizz
Teachers' Resource

Name: . . . . . Class: . . . . . .

Measures

Write these distances in metres (m).

Q1

1 km = ☐ m

Q2

5 km = ☐ m

Q3

10 km = ☐ m

Q4

One half of 1 km = ☐ m

Q5

Three quarters of 1 km = ☐ m

Q6

One tenth of 1 km = ☐ m

Write these distances in kilometres (km).

Q7

3000 m = ☐ km

Q8

6000 m = ☐ km

Q9

11 000 m= ☐ km

Q10

2250 m = ☐ km

Q11

3900 m = ☐ km

Q12

43 800 m = ☐ km

Whizz Education © 2014

LIVEWORKSHEETS