Codingal

Count the objects in each set. Compare using >, <, or = as appropriate.

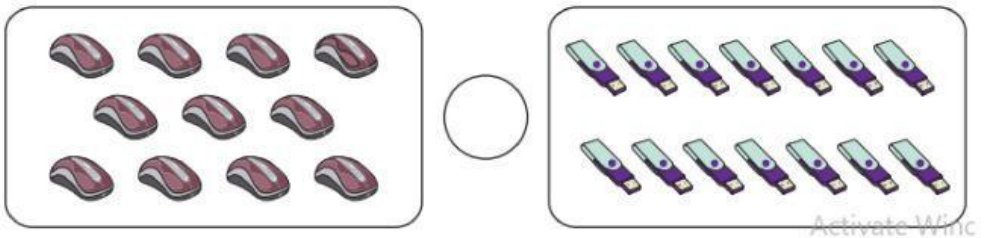

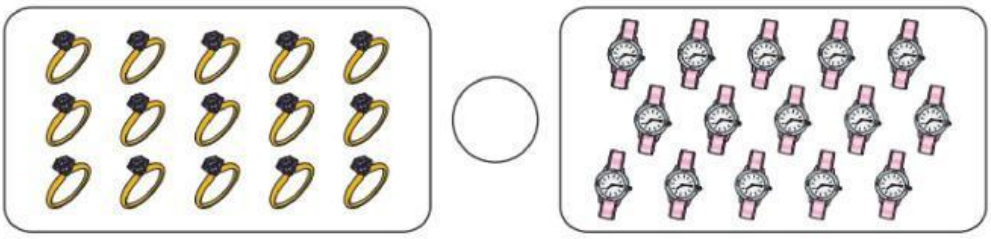

Write the numbers in order from the smallest on the left to the largest.

1) 54, 31, 78 _____ < _____ < _____

2) 12, 34, 26 _____ < _____ < _____

3) 63, 5, 74 _____ < _____ < _____

What comes before, after and between.

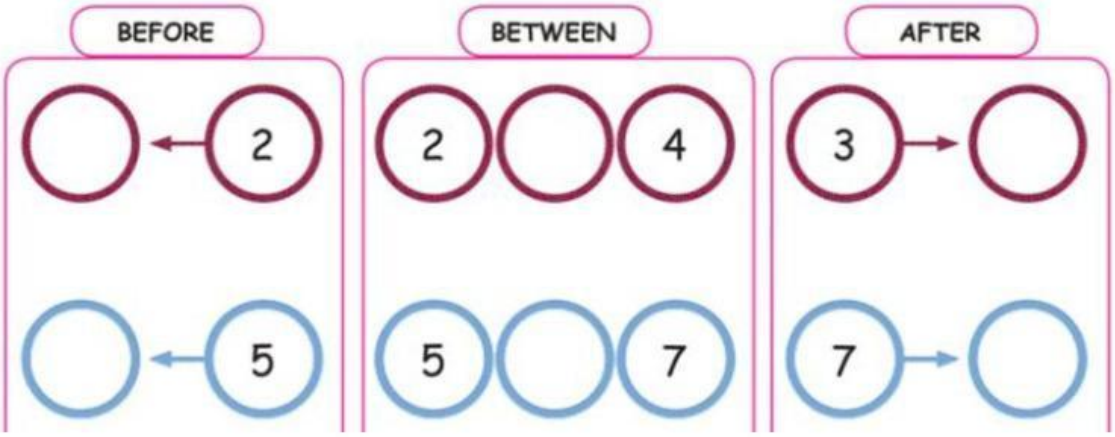

Determine the place value of the underlined digit.

_____ = 4 tens and 8 ones

_____ = 8 tens and 2 ones

_____ = 6 tens and 7 ones

_____ = 5 tens and 4 ones

LIVEWORKSHEETS