Name: _____ Class: _____

Write the fractions and decimals based on the coloured parts of diagram.

$\frac{4}{10}$ $\frac{9}{10}$ $\frac{5}{10}$ $\frac{6}{10}$ $\frac{7}{10}$

0.6 0.9 0.4

0.5 0.7

diagram		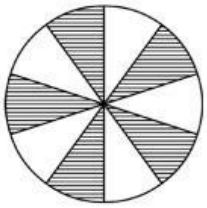		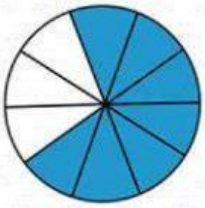	
fraction					
decimal					

LIVEWORKSHEETS

Look at the number line. Compare and write more than less than or equals

.

more than	more than	more than	equals
less than	less than	less than	equals

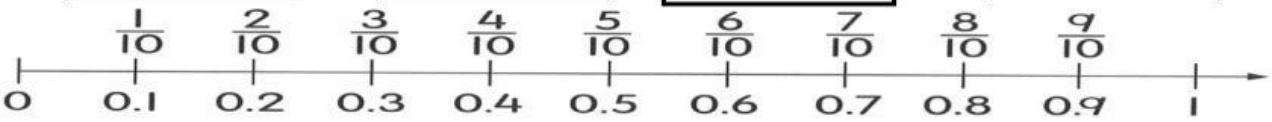

0.9		0.5	1/10		0.5
0.3		0.6	7/10		0.7
7/10		4/10	0.9		5/10
2/10		8/10	0.2		2/10

LIVEWORKSHEETS