WORKSHEET

EXCRETORY SYSTEM

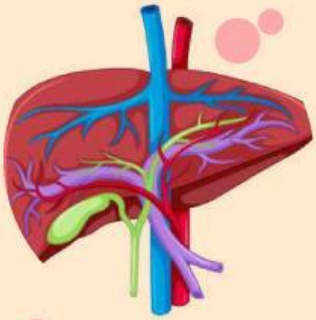

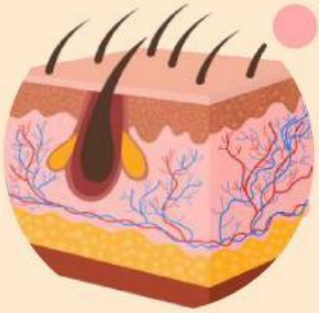

GROUP:

CLASS:

LIVEWORKSHEETS

WORKSHEET

EXCRETORY SYSTEM

A. KIDNEY

Please watch the video below.

Based on the video, write down the solution that can solve the problem:

_____

_____

_____

_____

LIVEWORKSHEETS

WORKSHEET

EXCRETORY SYSTEM

B. KIDNEY STRUCTURE

Open the module and match the name of structure with the label.

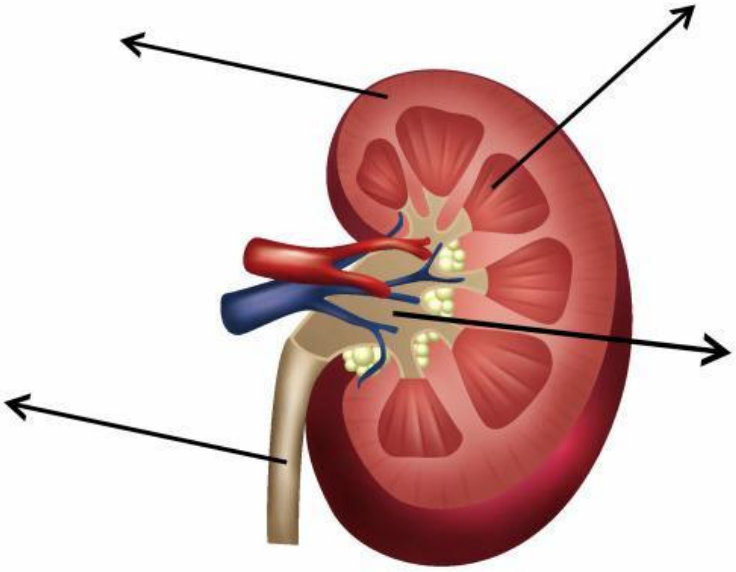

Ureter

Pelvic

cortex

Medulla

LIVEWORKSHEETS

WORKSHEET

EXCRETORY SYSTEM

C. NEPRHON STRUCTURE

The unit functional of the kidney is called _____.
Please complete the structure of the nephron below.

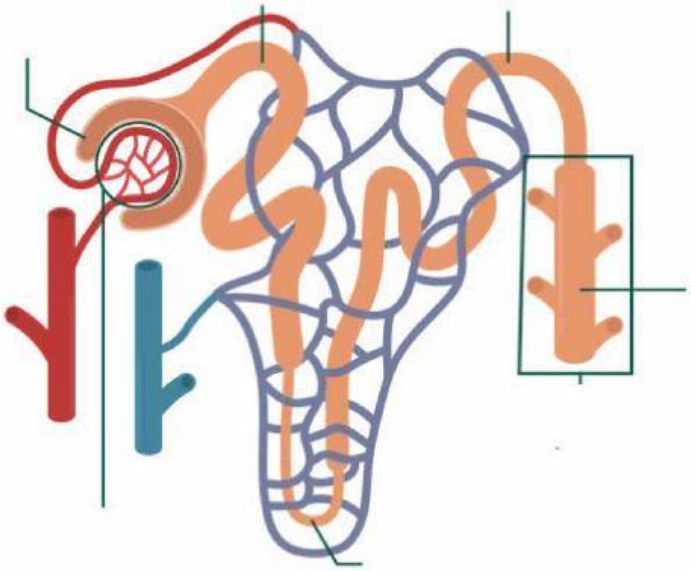

The Process of urine formation:

1. _____ is filtering blood into filtrate, occur in glomerolus and bowman capsule.
2. _____ is reabsorbing substance that is needed by body, like glucose, amino acid, water and ion, except urea. Occur in _____
3. _____ is moving non-essential substance from blood and excrete urine.

LIVEWORKSHEETS

WORKSHEET

EXCRETORY SYSTEM

D. MAKE A POSTER

After you study about Kidney, and see the new about kidney failure, please make a poster about the preventive action to keep our kidney health.

You and your group can draw it or make it by digital apps.
Upload your poster in link below:

https://s.id/KIDNEYPOSTER

Submit your worksheet whit teacher code:

90mfh4rt087

LIVEWORKSHEETS