LATIHAN : CIRI-CIRI PETA LAKAR

ARAH MATA ANGIN | SIMBOL | PETUNJUK

PEMIDANG | TAJUK

A. Nyatakan ciri-ciri peta lakar di bawah.

1. _____

2. _____

3. _____

4. _____

5. _____

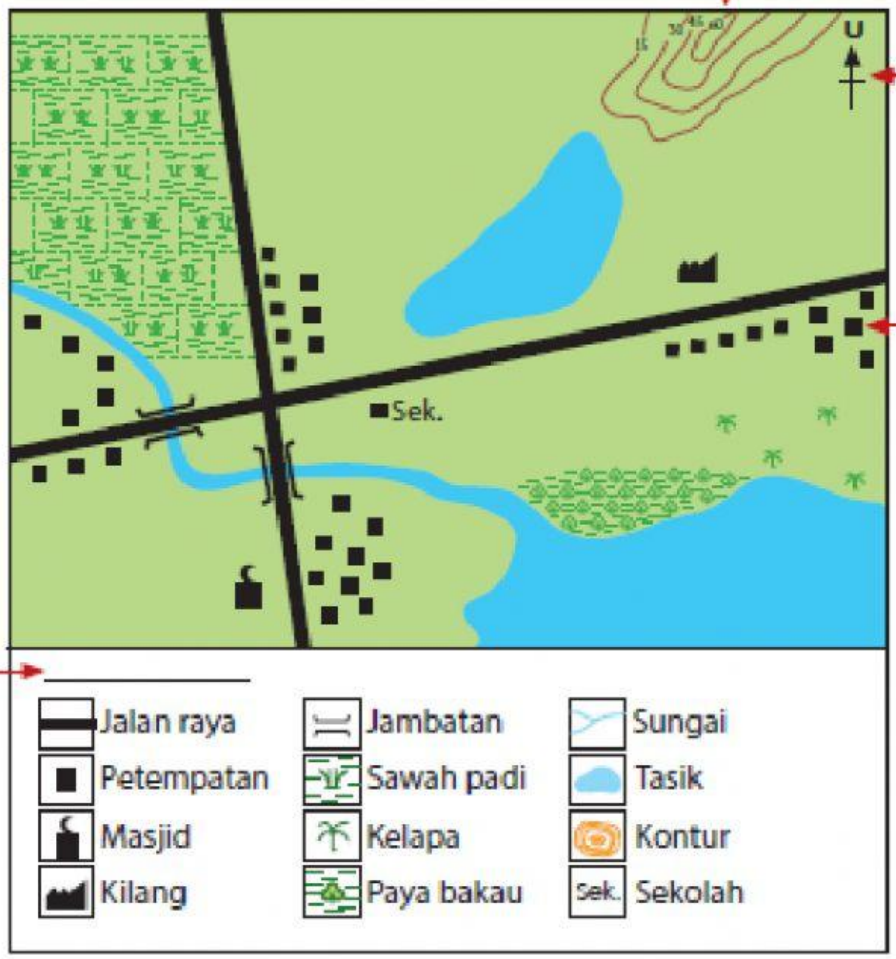

LIVEWORKSHEETS

LATIHAN : SIMBOL-SIMBOL DALAM PETA LAKAR

B. Nyatakan maksud simbol-simbol yang berikut:

1.  _____

2. 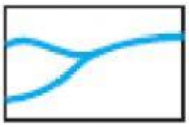 _____

3. _____

4.  _____

5. 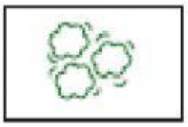 _____

6. _____

LIVEWORKSHEETS