Codingal

# Area & Perimeter of a Rectangle

Directions: Find the area and perimeter of each rectangle.

1.




Area =

Perimeter =

2.

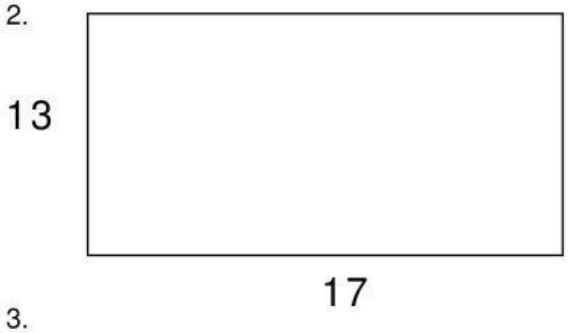


Area =

Perimeter =

3.




Area =

Perimeter =

4.

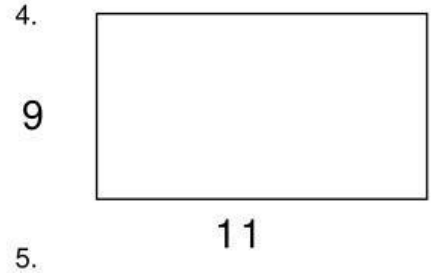


Area =

Perimeter =

5.




Area =

Perimeter =

© This area and/or perimeter worksheet is from www.teach-nology.com

LIVEWORKSHEETS