1ST ASSESSMENT: NUMBERS UP TO 1000
MATHEMATICS YEAR 2 2021

(A) Complete the following.

	Numeral	Number word
1.	718	
2.	407	
3.		One hundred and sixty-two
4.		Five hundred and forty-three

(B) Count and match.

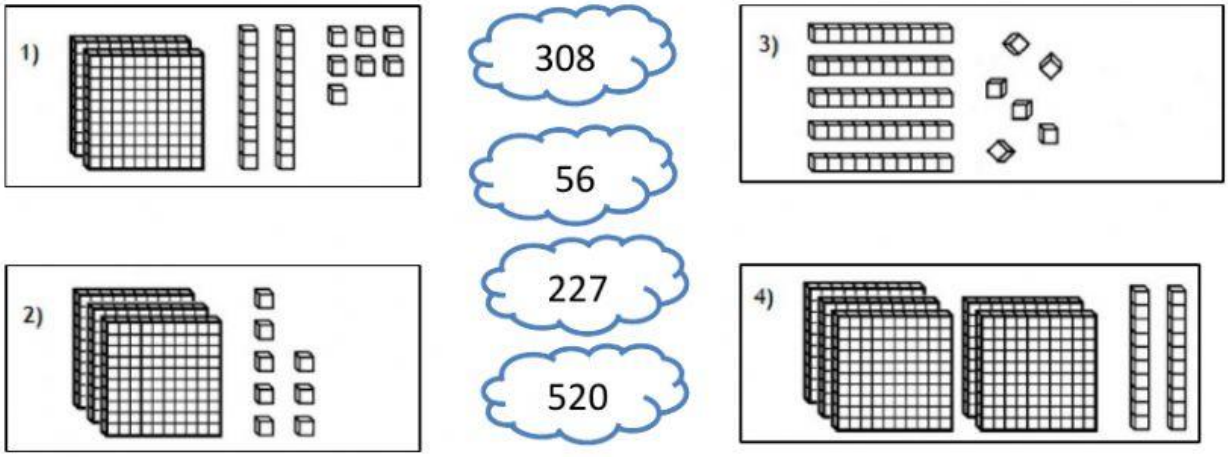

(C) Write the place value and digit value for the underlined digits.

Number	Place value	Digit value
45<u>0</u>	ones	0
6<u>1</u>2		
79<u>3</u>		
<u>8</u>02		

(D) Partition these numbers.

a 297 2 hundreds + 9 [ ] + 7 [ ]

b 605 [ ] + 0 tens + [ ]

c 814 800 + [ ] + [ ]

d 930 [ ] + 30 + [ ]

LIVEWORKSHEETS

(E) Tick the smaller number.

1. 417 471

2. 511 512

3. 173 137

4. 296 269

(F) Arrange the numbers.

1. Arrange the numbers in ascending order.



_____

2. Arrange the numbers in descending order.



_____

(G) Round off the numbers to the nearest 10.

1. 513: _____

2. 385: _____

3. 679: _____

(H) Round off the numbers to the nearest 100.

1. 997: _____

2. 148: _____

3. 96: _____

LIVEWORKSHEETS

(I) Complete the number patterns.

1. 774 764 754 _ 734

2. 101 201 _ 401 501

3. 850 _ 856 859 862

4. _ 575 569 563 557

Prepared by: Mdm Ting Nai

LIVEWORKSHEETS