Kurikulum
Merdeka

# Lembar Kerja Peserta Didik

# MATEMATIKA

## Materi : Bilangan Pecahan

Nama :

Kelas :

Disusun oleh : Arismiwati, S.Pd

LIVEWORKSHEETS

Tuliskan berapa nilai pecahan berikut ini.



$\frac{1}{4}$







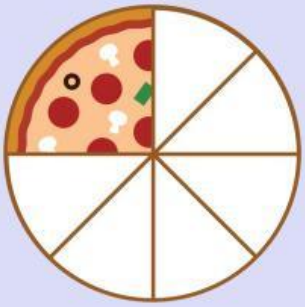

LIVEWORKSHEETS

Perhatikan arsiran pada lingkaran.
Bandingkan dan berilah tanda <, >, atau =.

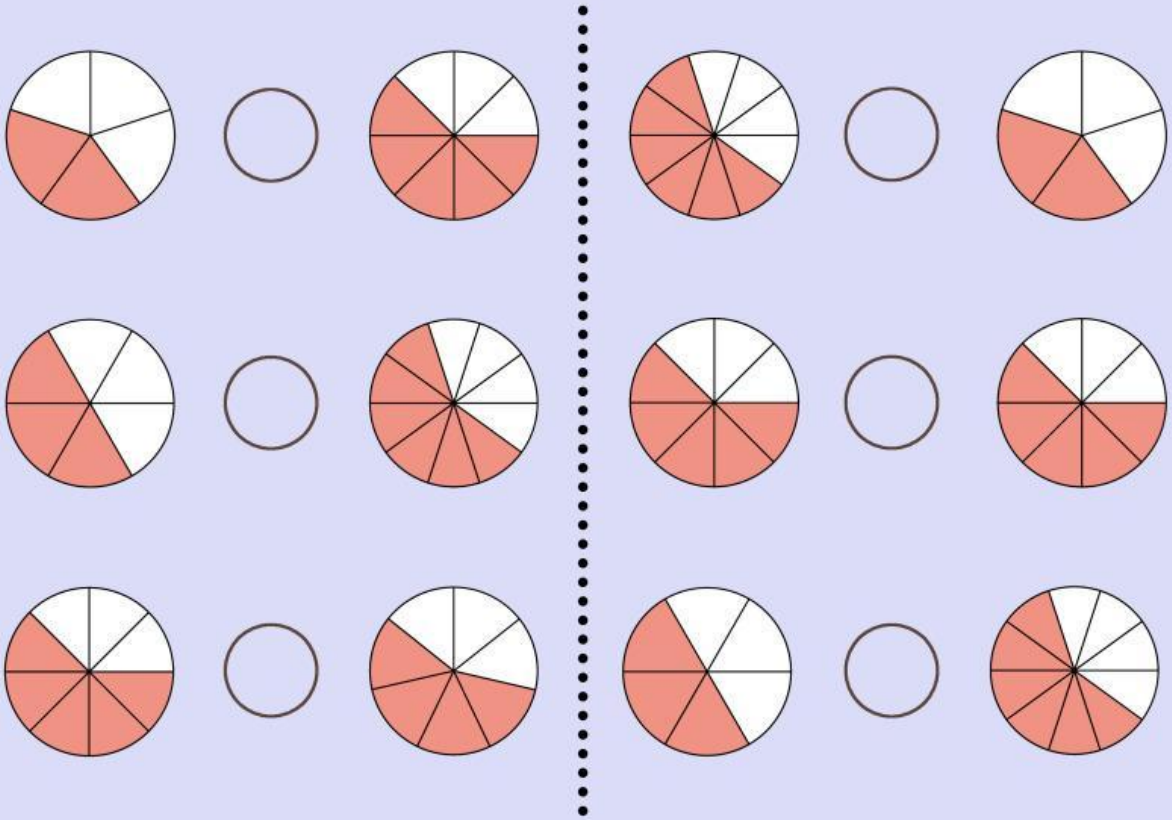

## Menghitung Pecahan Sederhana

1. $\frac{1}{3} + \frac{3}{3} = \frac{\square}{3}$

2. $\frac{10}{6} - \frac{5}{6} = \frac{\square}{6}$

3. $\frac{12}{2} + \frac{8}{2} = \frac{\square}{2}$

4. $\frac{12}{4} - \frac{5}{4} = \frac{\square}{4}$

LIVEWORKSHEETS