Volume dan Luas Permukaan *Prisma & Limas*

VIII

Nama :
Kelas :
Tanggal :

RUMUS	Prisma Segitiga Sama Sisi	Limas Persegi
Volume	$Luas\ Alas \cdot T_{prisma}$ $(\frac{1}{2} \cdot alas \cdot T_{alas})T_{prisma}$	$\frac{1}{3} \cdot luas\ alas \cdot tinggi$ $\frac{1}{3} \cdot s \cdot s \cdot tinggi$
Luas Permukaan	$(2 \cdot La) + (kel\ alas \cdot t)$	$Luas\ alas + Luas\ sisi\ tegak$ $(s \cdot s) + (4 \cdot \frac{1}{2} \cdot alas \cdot t)$

Hitunglah volume dan luas permukaan bangun prisma dan limas di bawah ini!

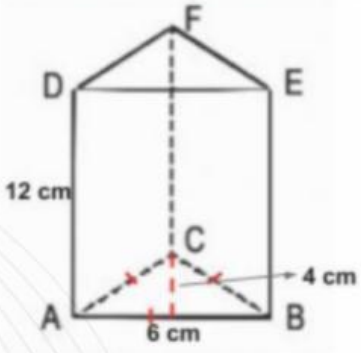

V = ___ × ___ × ___ = ___ cm³

Lp = (___ × ___ × ___) + (___ × ___) = ___ cm²

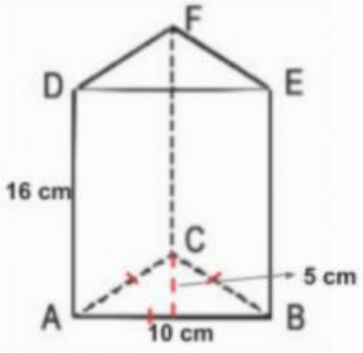

V = ___ × ___ × ___ = ___ cm³

Lp = (___ × ___ × ___) + (___ × ___) = ___ cm²

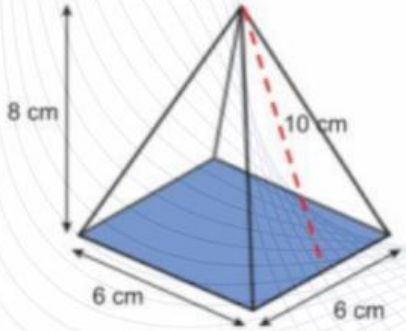

V = ___ × ___ × ___ = ___ cm³

Lp = (___ × ___ × ___) + (___ × ___) = ___ cm²

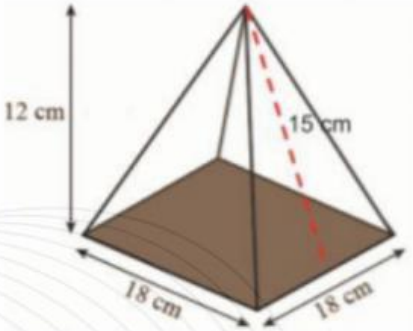

V = ___ × ___ × ___ = ___ cm³

Lp = (___ × ___ × ___) + (___ × ___) = ___ cm²

LIVEWORKSHEETS