AL TAAWUN SCHOOL

CA Assessment 3- Term 1 Week 11- 2024 **: 60 marks**

Write in the boxes

المربعات في اكتب

Q1. *Write in multiplication expression* الضرب تعبير في الكتابة

$10^6 = \square \times \square \times \square \times \square \times \square \times \square$

Q2. *Write in exponential form* الأسي شكل في الكتابة

$\mathbf{10 \times 10 \times 10 \times 10 \times 10 = \square^{\square}}$

Q3. *Write in exponential form* الأسي شكل في الكتابة

10,000 = $\square^{\square}$

Q4. *What is the product* المنتج هو ما

$\mathbf{24 \times 100000 =} \square$

Q5. *What is the product* المنتج هو ما

$\mathbf{60 \times 10^4 =} \square$

LIVEWORKSHEETS

Q6. *What is the unknown factor* المجهول العامل هو ما

$$28 \times \boxed{} = 280000$$

Q7. *Complete Area Model*

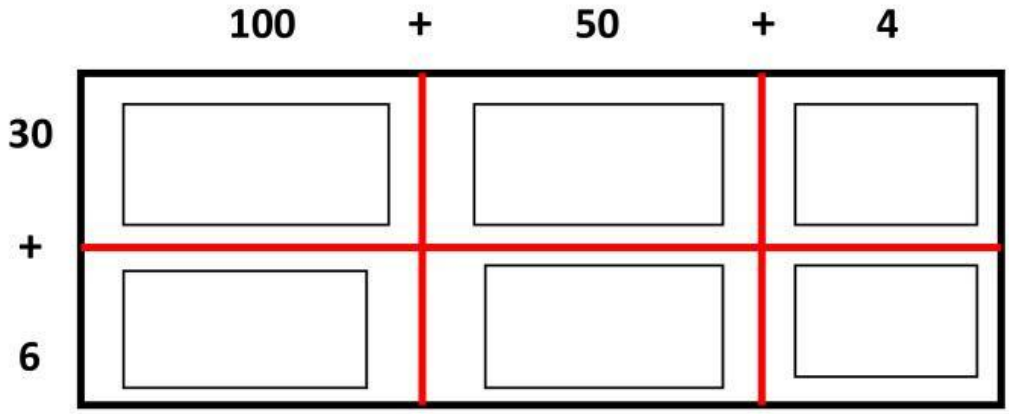

Q8. *Use Area Model to solve the product*

$$15 \times 24$$

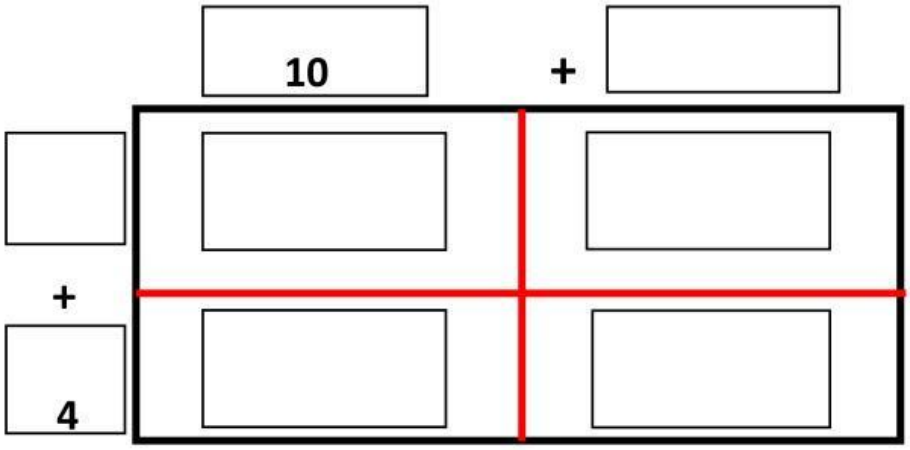

$$15 \times 24 = \boxed{}$$

LIVEWORKSHEETS

Q9. *Find the unknown partial products*. Then find the product

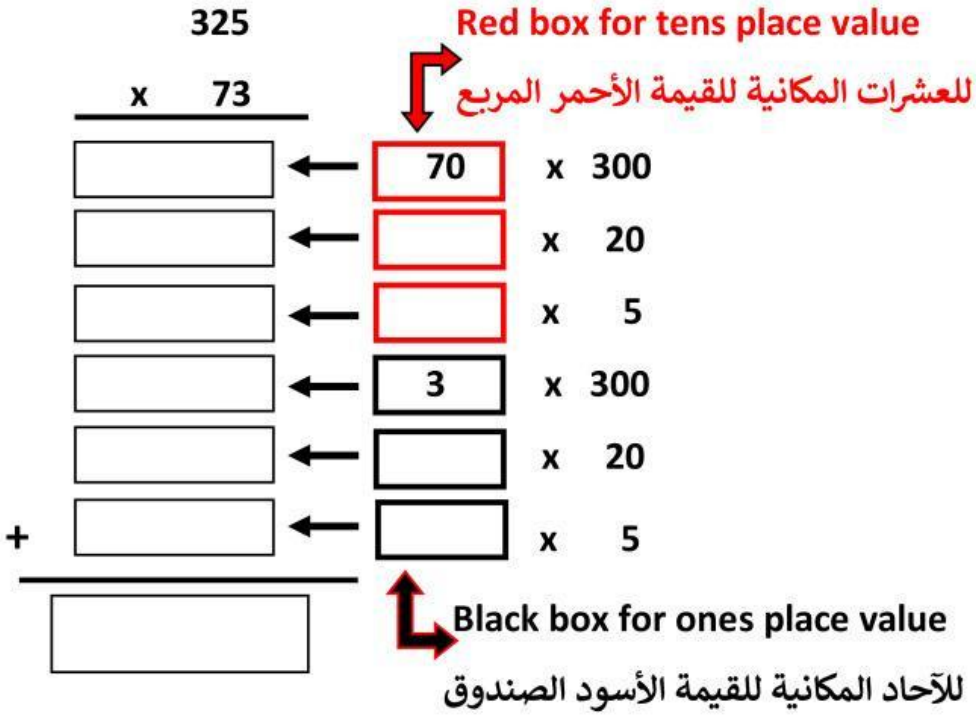

Q10. *Find the unknown partial products*. Then find the product

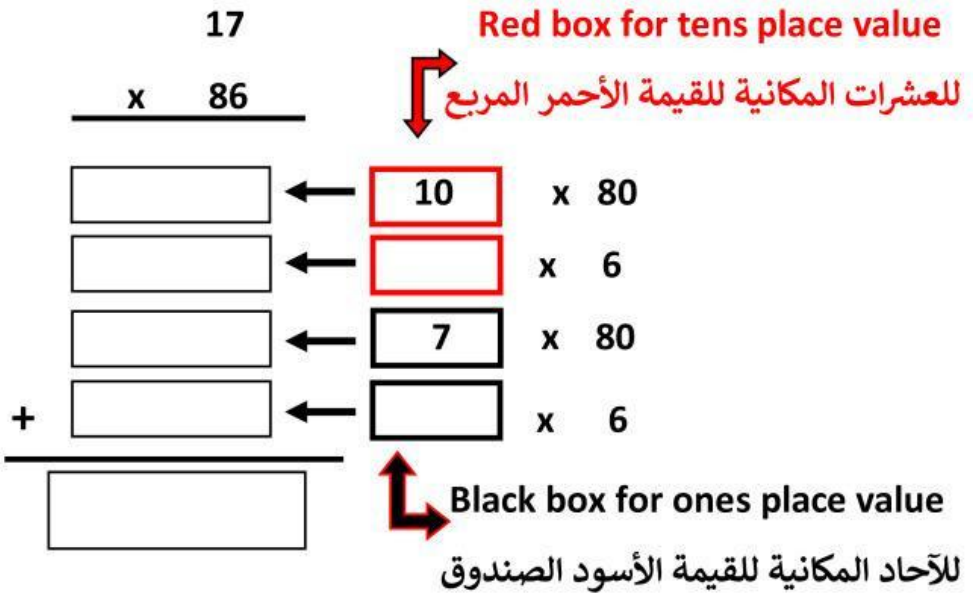

LIVEWORKSHEETS

Q11. *What is the product* المنتج هو ما

$$\begin{array}{r} 327 \\ \times \quad 6 \\ \hline \boxed{} \end{array}$$

Q12. *What is the product* المنتج هو ما

$$\begin{array}{r} 543 \\ \times \quad 8 \\ \hline \boxed{} \end{array}$$

Q13. *Use Area Model to solve the product*

$$218 \times 28$$

	200	+		+	8
+					
8					

$$218 \times 28 = \boxed{}$$

LIVEWORKSHEETS

Q14.

What is the product. Choose the correct answer and write any one A or B or C or D in the box for your selected answer

$$188 \times 7 = s$$

A. $s = 1300$

B. $s = 1316$

C. $s = 1388$

D. $s = 1406$

Q15.

What is the product. Choose the correct answer and write any one A or B or C or D in the box for your selected answer

$$25 \times 7 = s$$

A. $s = 174$

B. $s = 176$

C. $s = 175$

D. $s = 140$

Q16.

What is the product. Choose the correct answer and write any one A or B or C or D in the box for your selected answer

$$120 \times 2 = s$$

A. $s = 100$

B. $s = 200$

C. $s = 240$

D. $s = 109$

****

LIVEWORKSHEETS