1-CHOOSE THE CORRECT ANSWER

1. Plants...
   a) Are herbivores
   b) Carry out photosynthesis
   c) Are viviparous
2. Multicellular living things include...
   a) Bacteria
   b) Protozoa
   c) Animals and plants
3. Plant cells have...
   a) A rigid cell wall and chloroplasts
   b) An irregular shape
   c) An elastic wall
4. The levels of organisations are:
   a) Cell, tissue, organ, system, organism
   b) Cell, organ, tissue, system, organism
   c) Cell, tissue, organ, organism, system
5. Fungi
   a) Make their own food
   b) Can move about
   c) Are unicellular or multicellular

2-CIRCLE THE CORRECT WORD

a) Living things need **energy / sunlight** to carry out movement.

b) **Herbivores / Omnivores** eat both plants and other animals.

c) **Plants / Carnivores** make their own food.

d) Plants carry out **movement / photosynthesis** to make food.

3-COMPLETE THE TEXT ABOUT THE PROCESS OF SENSITIVITY. USE THESE WORDS.

sense organs - detect - plants - environment - respond - movement

Sensitivity is the process by which living things _____. and respond to changes in their _____ .

Animals detect information through their _____ and they respond with _____ . _____ cannot move about but they detect and _____ to changes.

4-MATCH

1-Cells are....	...of more than one cell
2-We can only see cells...	...through a microscope
3-Multicellular living things are made up...	... of just one cell
4-Unicellular living things are made up...	...the basic units of life

LIVEWORKSHEETS

5- READ AND WRITE THE PART OF THE CELL

cytoplasm - nucleus - organelles - cell membrane

a. Internal part which controls what happens in the cell. --> _____

b. Liquid part between the nucleus and the membrane. --> _____

c. Thin, permeable skin that separates the interior of the cell from the outside. --> _____

d. They are situated in the cytoplasm. --> _____

6-WRITE THE PARTS

ANIMAL CELLS

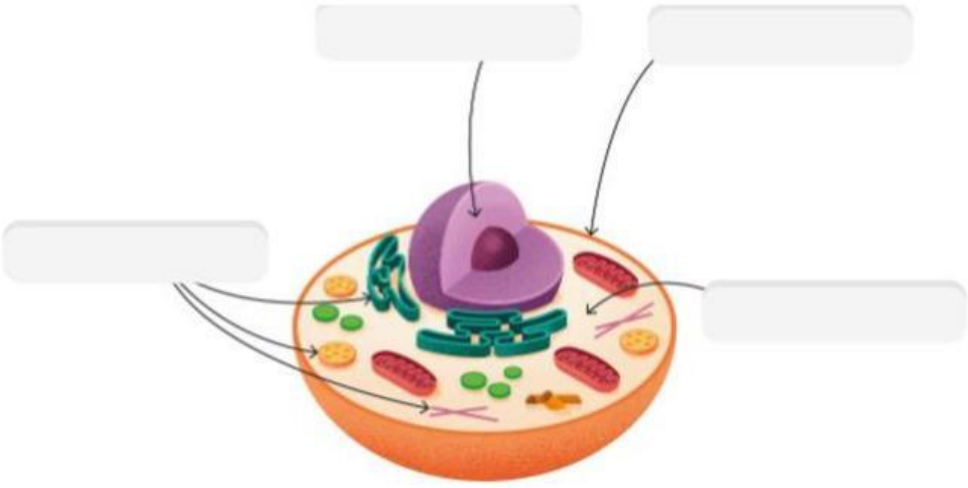

PLANT CELLS

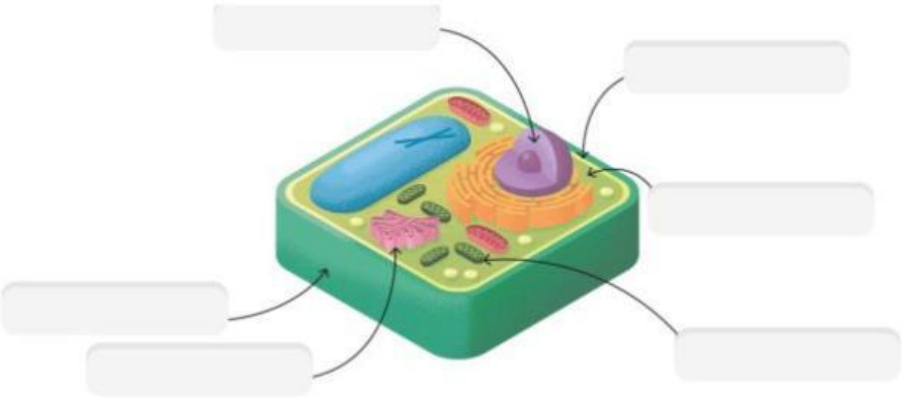

LIVEWORKSHEETS

7-LABEL THE LEVELS OF ORGANISATIONS

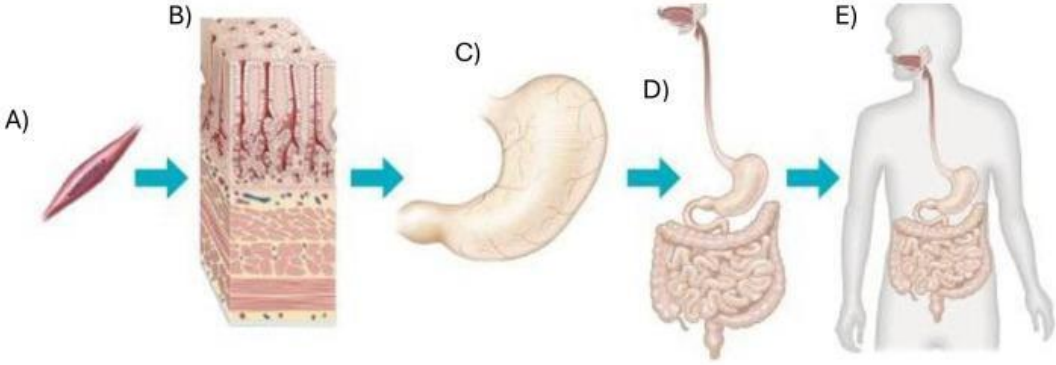

A-

B-

C-

D-

E-

8-IDENTIFY THE 5 KINGDOMS

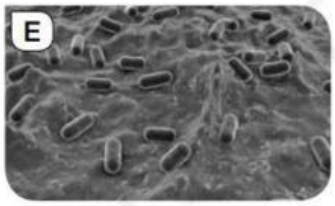

LIVEWORKSHEETS