ACTIVIDAD

1. **Resuelve los siguientes ejercicios.**

Objeto	Ejercicio	Solución
	15 cm → Convertir a metros	
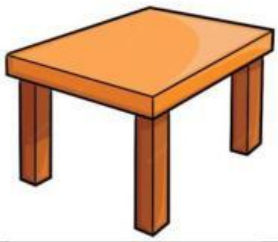	1.2 m → Convertir a centímetros	
	25 cm → Convertir a metros	
	2 m → Convertir a centímetros	
	30 cm → Convertir a metros	

LIVEWORKSHEETS