INSPIRED TOTS EARLY LEARNING CENTER

1ST TERM CONTINOUS ASSESSMENT, 2024

NAME: _____ DATE: _____

QUANTITATIVE GRADE 3

1. Arrang these numbers in ascending order

132, 139, 139, 203, 232, 122, 131,133, 134, 143.

_____,_____,_____,_____,_____,_____,_____,_____,_____,_____,_____

2). Arrang these numbers descending order.

234, 546, 534, 236, 764, 123, 208, 342, 276, 435

_____,_____,_____,_____,_____,_____,_____,_____,_____,_____

A	B	C	D	E	F	G	H	I	J	K	L	M
↓	↓	↓	↓	↓	↓	↓	↓	↓	↓	↓	↓	↓
1	2	3	4	5	6	7	8	9	10	11	12	13

Answer the following question using the codes above

3. E-C_____ 4. $\frac{LEAFJ}{B}$ _____5. I^2._____

6. $\frac{JKL}{K}$_____7.$\frac{B^2F}{5}$_____

Example ;

$M_3 = 9 => 3^2$ $N_{64} = 8 => \sqrt{64}$

8. M_4 =_____ 9.M_5=_____ 11. $N_{100} \times M_4$=_____

10. N_{64}=_____ 12. $N_{121} \times M_2$=_____

Study the examples below carefully and answer the question that follows.

LIVEWORKSHEETS

INSPIRED TOTS EARLY LEARNING CENTER

1ST TERM CONTINOUS ASSESSMENT, 2024

NAME: _____ DATE: _____

Examples:

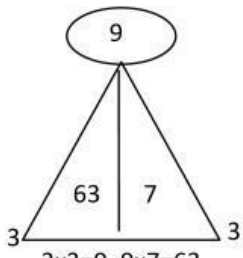

3x3=9, 9x7=63

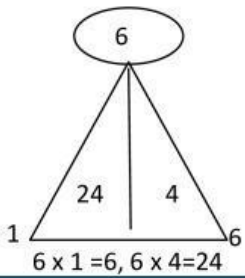

6 x 1 =6, 6 x 4=24

(14)

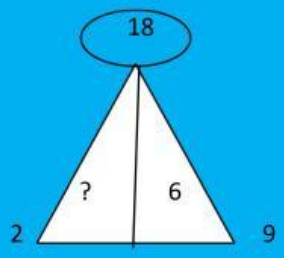

(15)

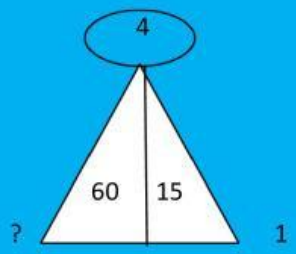

(16)

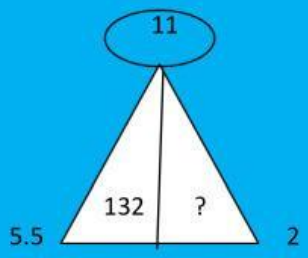

(17)

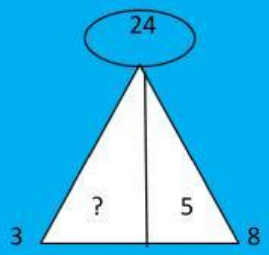

(18)

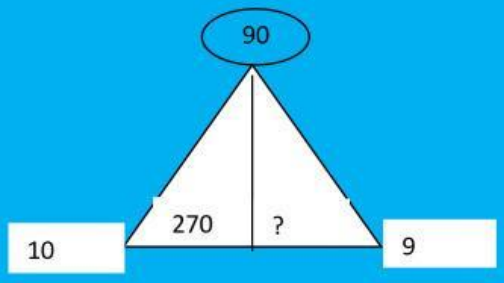

(19)

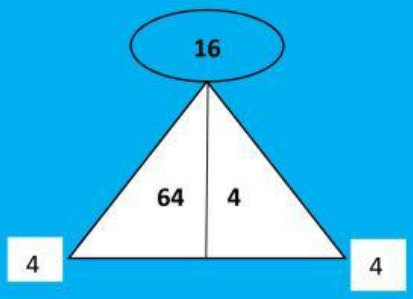

LIVEWORKSHEETS

INSPIRED TOTS EARLY LEARNING CENTER

1ST TERM CONTINOUS ASSESSMENT, 2024

NAME: _____ DATE: _____

(20)

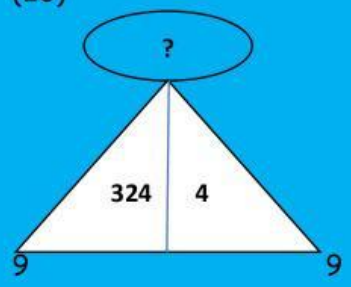

LIVEWORKSHEETS