Lembar Kerja Peserta Didik

# LKPD

## Bangun Ruang Sisi Lengkung

Nama : .....

Kelas : .....

LIVEWORKSHEETS

1. **Dibawah ini Jaring-jaring tabung yang benar adalah**

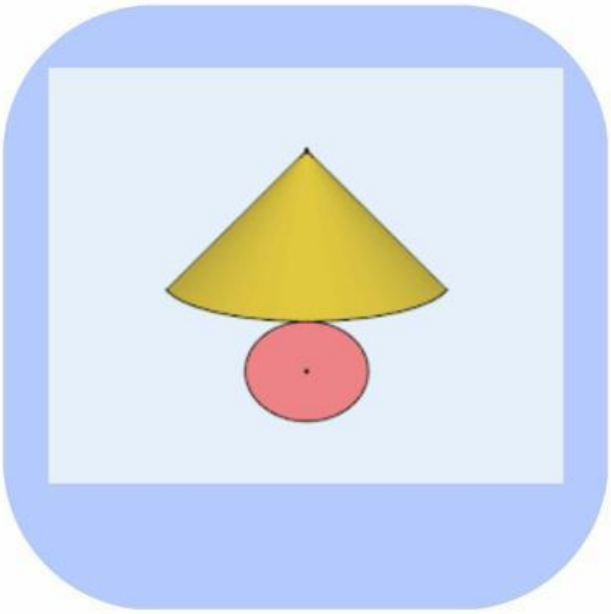

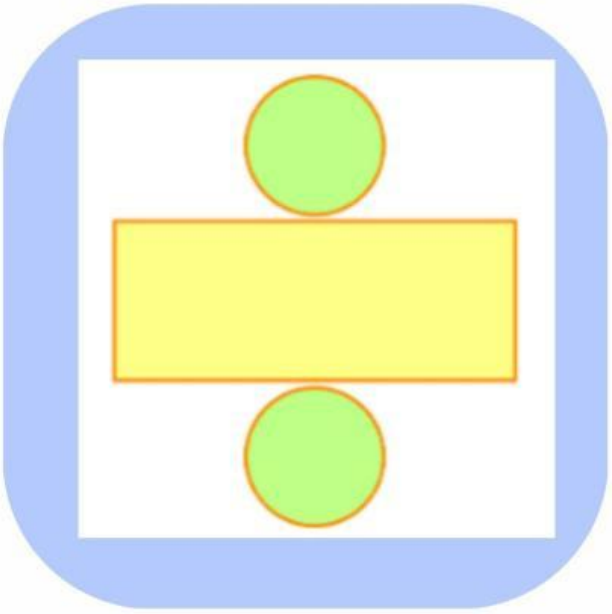

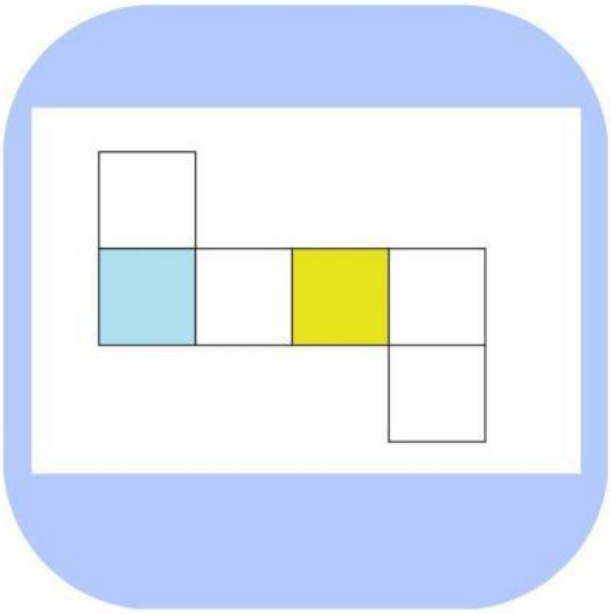

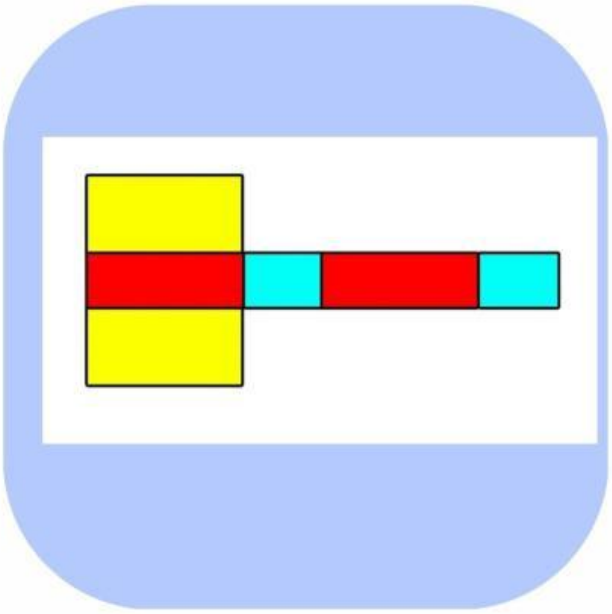

LIVEWORKSHEETS

# 2. sebutkan bentuk bangun ruang benda dibawah ini

LIVEWORKSHEETS

# 3. Isilah tabel ini dengan benar bedasarkan jumlah

| Bangun Ruang | Sisi | Rusuk | Titik Sudut |
|---|---|---|---|
| Tabung | | | |
| Kerucut | | | |
| Bola | | | |

# 4. Jodohkan Luas dan Volume dengan bangun ruang

**bangun ruang**

**Volume & Luas**

$4\pi r^2$

$\pi r(r+s)$

$\frac{1}{3} \times \pi r^2 t$

$\frac{4}{3} \times \pi r^3$

$2\pi r(r+t)$

$\pi r^2 \times t$

LIVEWORKSHEETS