Nama : _____

Kelas : _____

LUAS DAN KELILING

Rumus

Persegi

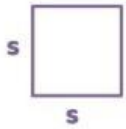

K = 4 x s

L = s x s

Persegi Panjang

K = p + p + l + l

L = p x l

Hitung luas dan keliling bangun datar di bawah ini!

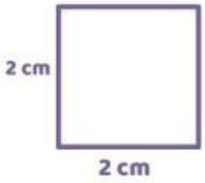

K = 4 x 2 = 8

L = 2 x 2 = 4

K = 2 + 4 + 2 + 4 = 16

L = 2 x 4 = 8

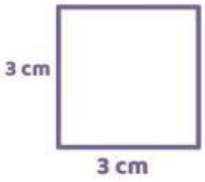

K = 4 x 3 = 12

L = 3 x 3 = 9

K = ☐ + ☐ + ☐ + ☐ = ☐

L = ☐ x ☐ = ☐

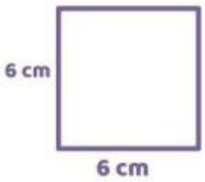

K = ☐ x ☐ = ☐

l = ☐ x ☐ = ☐

K = ☐ + ☐ + ☐ + ☐ = ☐

L = ☐ x ☐ = ☐

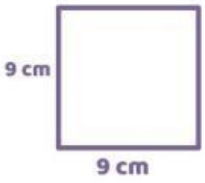

K = ☐ x ☐ = ☐

L = ☐ x ☐ = ☐

K = ☐ + ☐ + ☐ + ☐ = ☐

l = ☐ x ☐ = ☐

LIVEWORKSHEETS