Name:

Grade and Section:

Date:

SPIKE PRIME KIT

ELEMENT OVERVIEW

Instruction: Look at the pictures and identify what spike prime element it is. **Type the letter of your answers in capital letters only**. Please refer to the elements overview file provided by your teacher in order to be guided.

A. KYLE	E. TECHNIC ANG. BEAM	I. WHEEL
B. DISTANCE SENSOR	F. TECHNIC FRAME 7X11	J. LARGE HUB
C. WIRE CLIP	G. FORCE SENSOR	K. BALL
D. CONNECTOR PEG	H. COLOR SENSOR	L. BALL CUP

	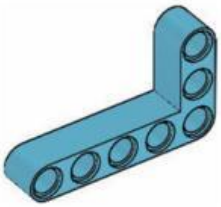	
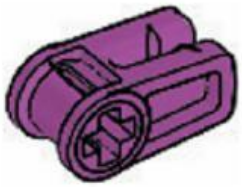		
	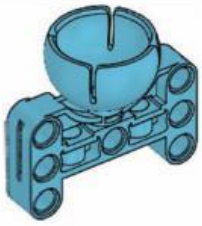	

LIVEWORKSHEETS