Reading Angles Using a Protractor – V1

Directions: *Write if the angle is acute, right, obtuse or straight. Then, read the angle measurement.*

1.

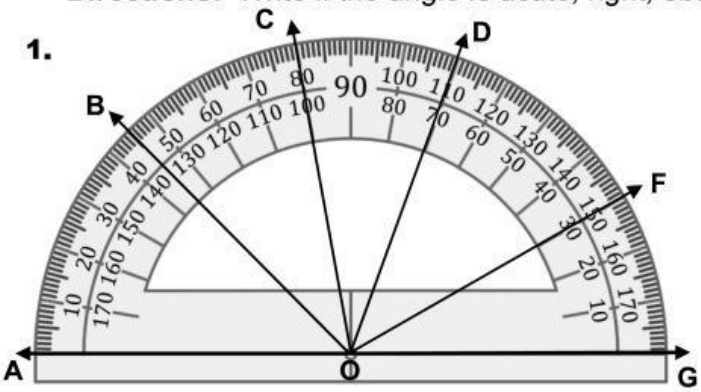

Angle AOB = Acute , 45°

Angle AOD = _____ , _____

Angle GOD = _____ , _____

2.

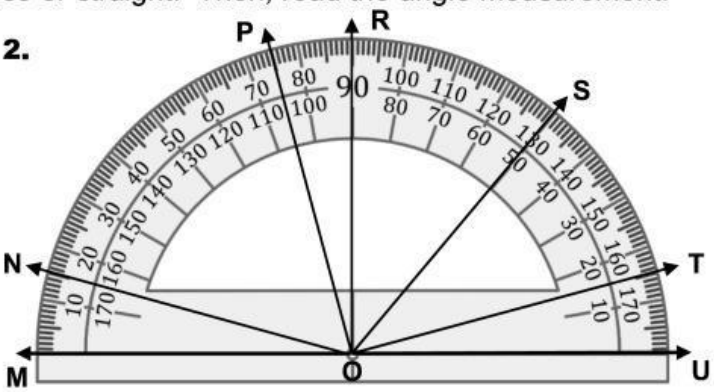

Angle MOR = _____ , _____

Angle MOS = _____ , _____

Angle UOS = _____ , _____

3.

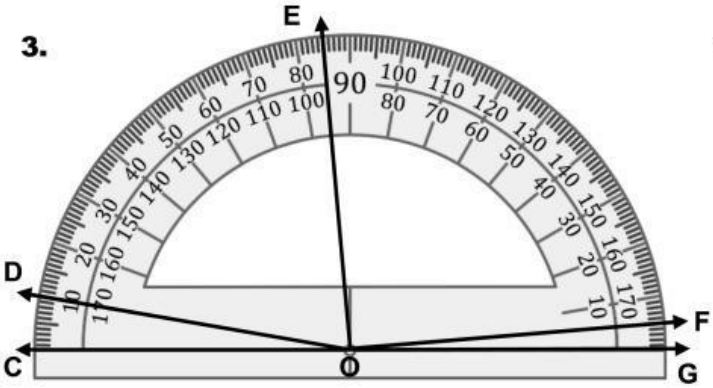

Angle COD = _____ , _____

Angle GOF = _____ , _____

Angle GOE = _____ , _____

4.

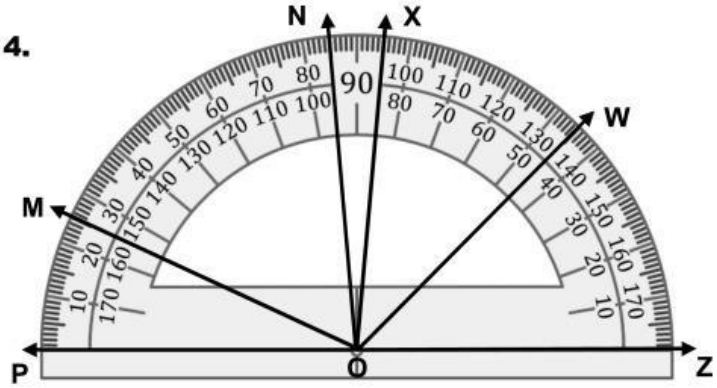

Angle POX = _____ , _____

Angle POW = _____ , _____

Angle ZOW = _____ , _____

5.

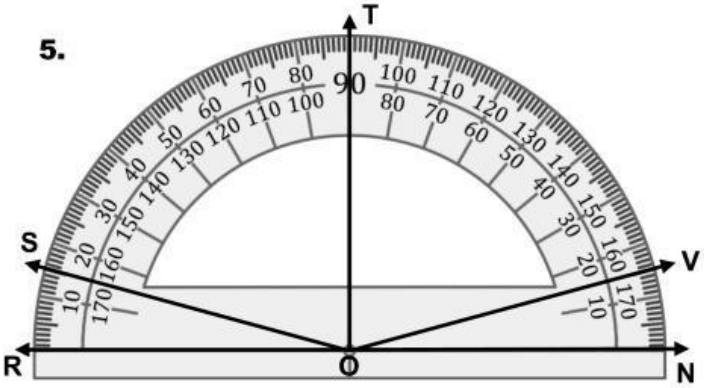

Angle ROV = _____ , _____

Angle NOT = _____ , _____

Angle NOS = _____ , _____

6.

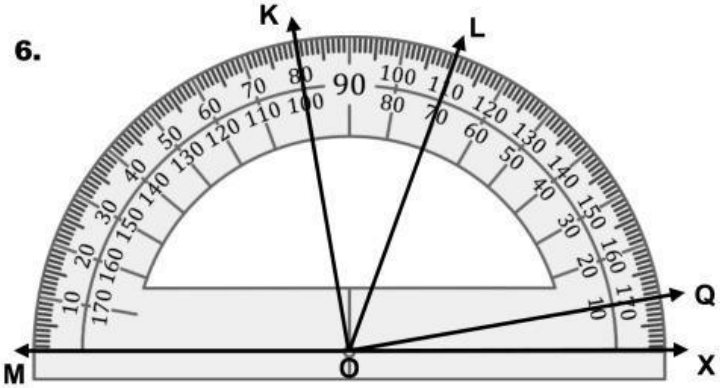

Angle MOL = _____ , _____

Angle MOX = _____ , _____

Angle XOQ = _____ , _____

Copyright © 2020, Amara Publishing, LLC

www.amara4education.com

LIVEWORKSHEETS