1. Indelis jogurto kainuoja 2 Eur. Tai sudaro $\frac{1}{3}$ sūrio kainos. Kiek eurų kainuoja sūris?

2. Nuspalvink nurodytą figūrų dalį. Trupmenas palygink.

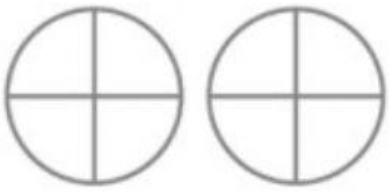

$\frac{1}{4} \square \frac{2}{4}$

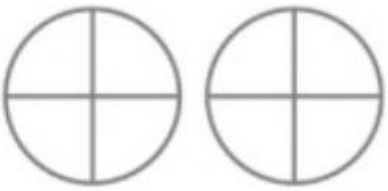

$\frac{2}{4} \square \frac{3}{4}$

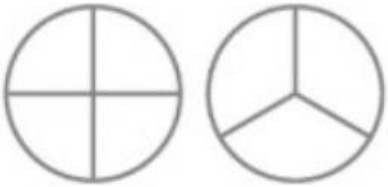

$\frac{2}{4} \square \frac{2}{3}$

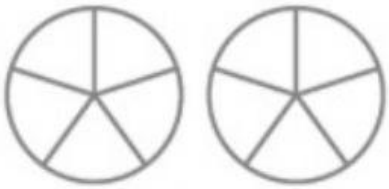

$\frac{2}{5} \square \frac{3}{5}$

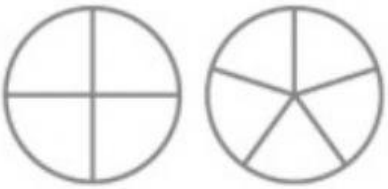

$\frac{1}{4} \square \frac{1}{5}$

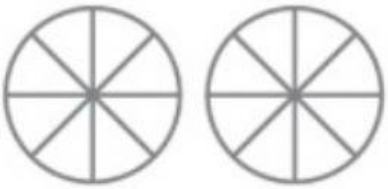

$\frac{5}{8} \square \frac{3}{8}$

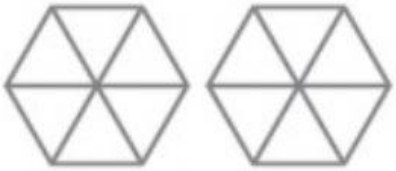

$\frac{4}{6} \square \frac{1}{6}$

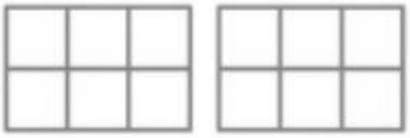

$\frac{1}{6} \square \frac{5}{6}$

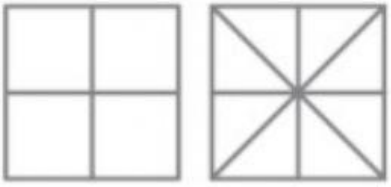

$\frac{1}{4} \square \frac{1}{8}$

3. Žodžiais parašyk, kurią dalį picos sudaro kiekvienas produktas.

.....

.....

.....

.....

LIVEWORKSHEETS