Name: _____ Date: _____

Answer all the questions. For the triangles that have whole numbers, give your answers as whole numbers and for those that have decimals round your answers to one decimal place. (1 d.p.)

Find the length of the side marked x. **(Classwork)**

1.

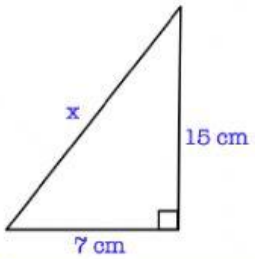

_____ cm

2.

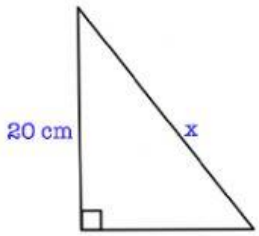

_____ cm

3.

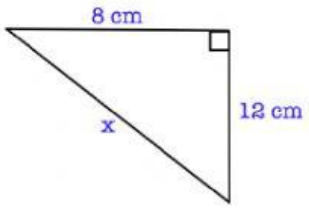

_____ cm

4.

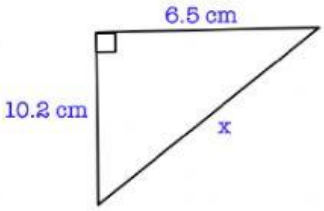

_____ cm

LIVEWORKSHEETS

Find the length of the side marked x. (Classwork)

5.

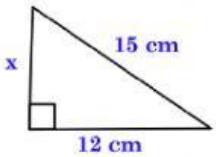

_____ cm

6.

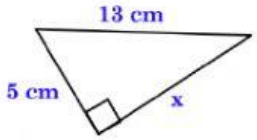

_____ cm

7.

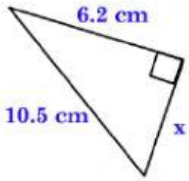

_____ cm

8.

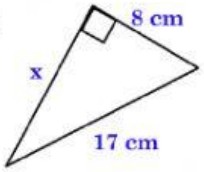

_____ cm

LIVEWORKSHEETS