Name: _____

# Surface Area

Surface area: The total area of the 2-dimensional surfaces that make up a 3-dimensional object.

Area of a rectangle: A = bh

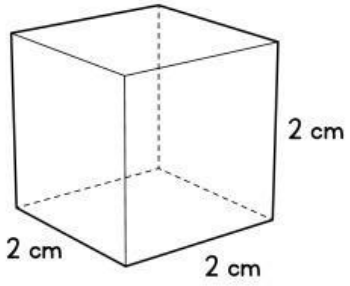


Front _____
Back _____
Top _____
Bottom _____
Side _____
Side _____

Surface area _____

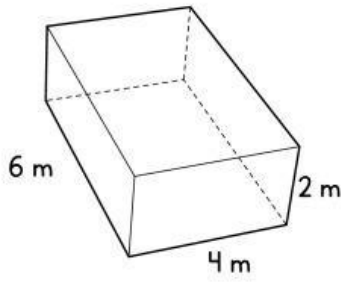


Front _____
Back _____
Top _____
Bottom _____
Side _____
Side _____

Surface area _____

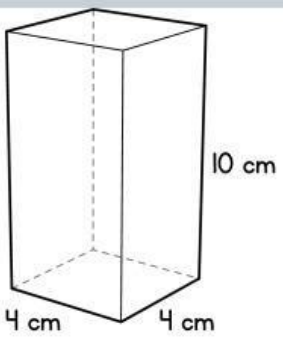


Front _____
Back _____
Top _____
Bottom _____
Side _____
Side _____

Surface area _____

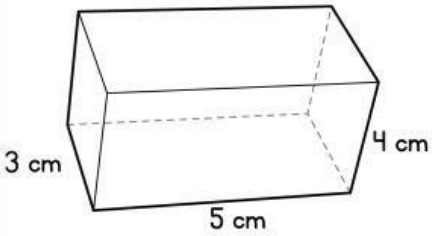


Front _____
Back _____
Top _____
Bottom _____
Side _____
Side _____

Surface area _____

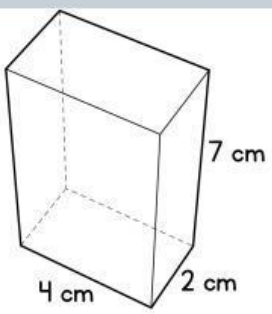


Front _____
Back _____
Top _____
Bottom _____
Side _____
Side _____

Surface area _____

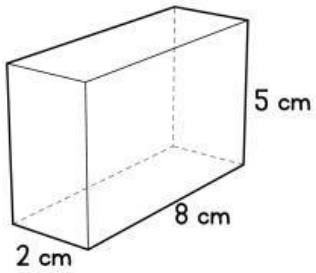


Front _____
Back _____
Top _____
Bottom _____
Side _____
Side _____

Surface area _____

LIVEWORKSHEETS

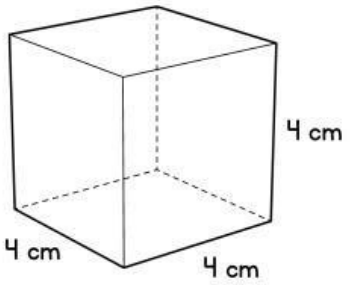


Surface area _____

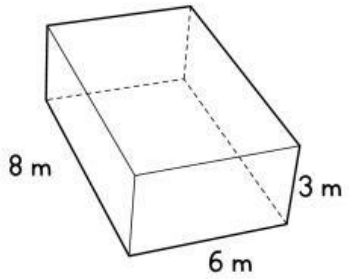


Surface area _____

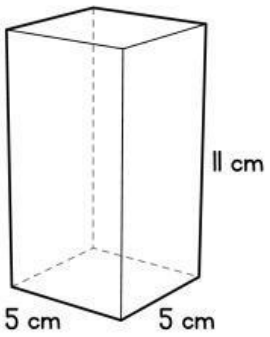


Surface area _____

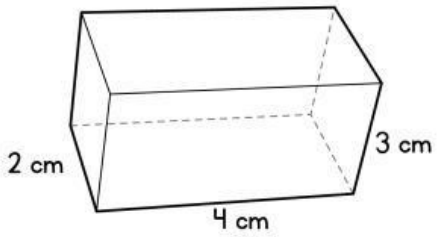


Surface area _____

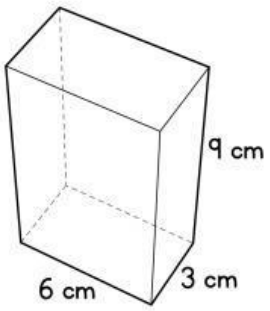


Surface area _____

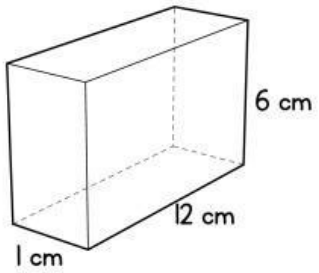


Surface area _____

LIVEWORKSHEETS

Name: Key

# Surface Area

Surface area: The total area of the 2-dimensional surfaces that make up a 3-dimensional object.

Area of a rectangle: A = bh

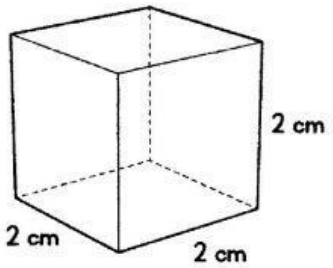


Front $4 cm^2$
Back $4 cm^2$
Top $4 cm^2$
Bottom $4 cm^2$
Side $4 cm^2$
Side $4 cm^2$

Surface area $24 cm^2$

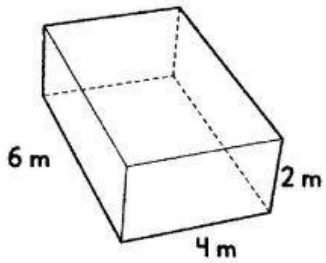


Front $8 m^2$
Back $8 m^2$
Top $24 m^2$
Bottom $24 m^2$
Side $12 m^2$
Side $12 m^2$

Surface area $88 m^2$

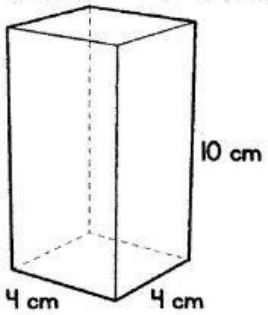


Front $40 cm^2$
Back $40 cm^2$
Top $16 cm^2$
Bottom $16 cm^2$
Side $40 cm^2$
Side $40 cm^2$

Surface area $192 cm^2$

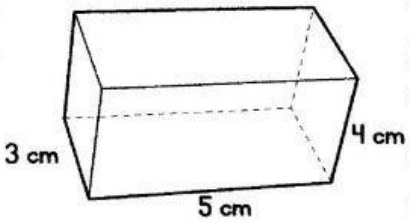


Front $20 cm^2$
Back $20 cm^2$
Top $15 cm^2$
Bottom $15 cm^2$
Side $12 cm^2$
Side $12 cm^2$

Surface area $94 cm^2$

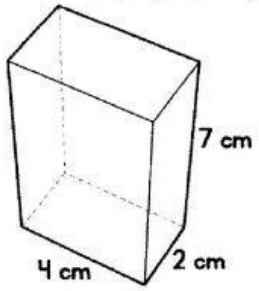


Front $28 cm^2$
Back $28 cm^2$
Top $8 cm^2$
Bottom $8 cm^2$
Side $14 cm^2$
Side $14 cm^2$

Surface area $100 cm^2$

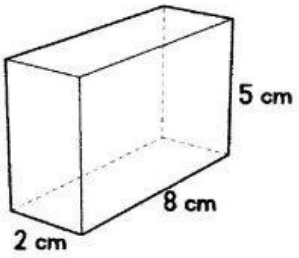


Front $40 cm^2$
Back $40 cm^2$
Top $16 cm^2$
Bottom $16 cm^2$
Side $10 cm^2$
Side $10 cm^2$

Surface area $132 cm^2$

LIVEWORKSHEETS

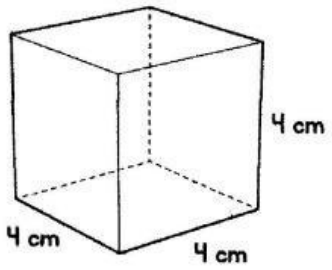


16
16
16
16
16
16

Surface area 96 $cm^2$

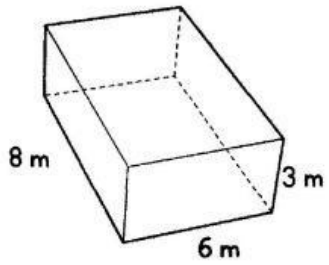


18
18
48
48
24
24

Surface area 180 $m^2$

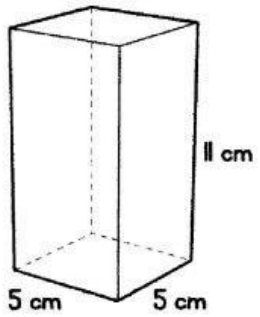


55
55
25
25
55
55

Surface area 270 $cm^2$

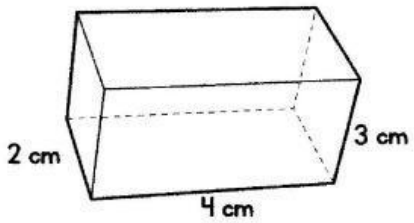


8
8
12
12
6
6

Surface area 52 $cm^2$

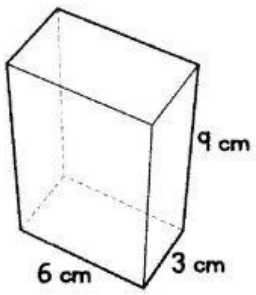


18
18
27
27
54
54

Surface area 198 $cm^2$

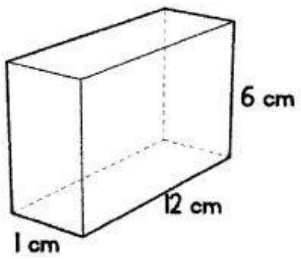


6
6
12
12
72
72

Surface area 180 $cm^2$

LIVEWORKSHEETS