JAWAB SEMUA SOALAN

1. Padankan imbangan dengan gambar di bawah. (TP 3)

1. 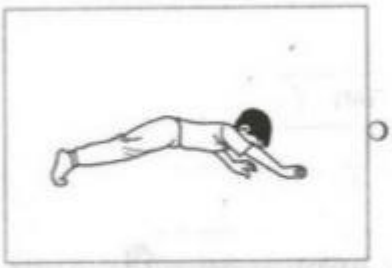

2. 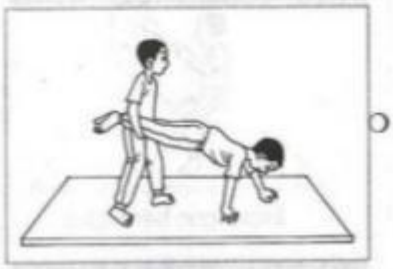

3. 

4. 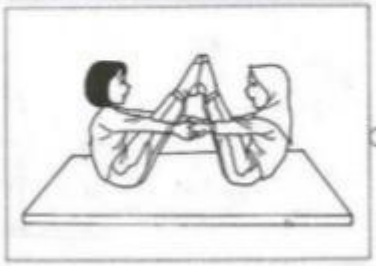

(a) Imbangan dekam

(b) Imbangan jambatan panjang

(c) Imbangan "V" berkembar

(d) Imbangan kereta sorong

LIVEWORKSHEETS