Name: Date:

TEOREMA PYTHAGORAS

Find the missing side in the right angled triangles.
Give your answers to 2 d.p.

1

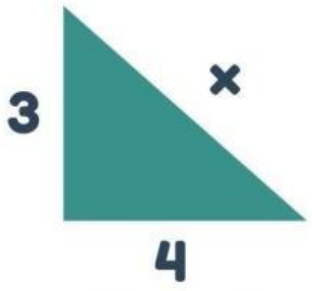

x = ____

2

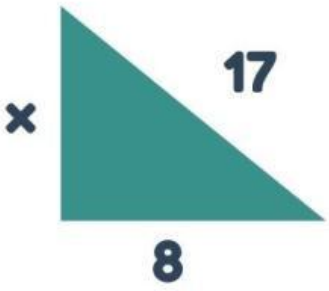

x = ____

3

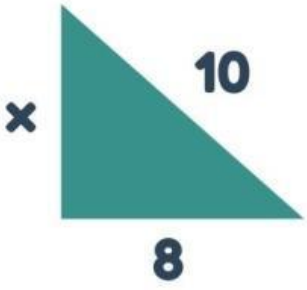

x = ____

4

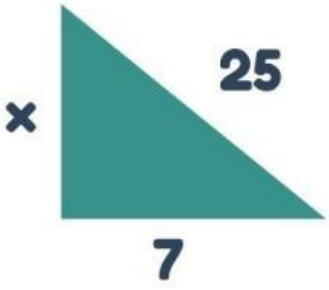

x = ____

5

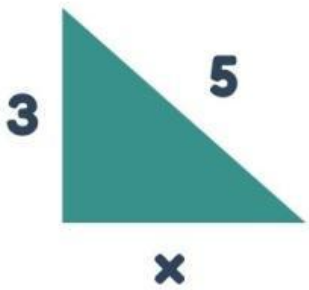

x = ____

6

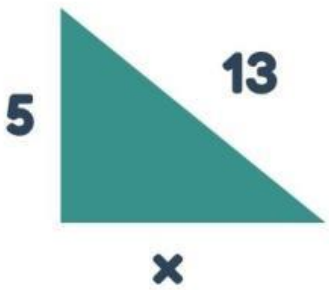

x = ____

LIVEWORKSHEETS