Converting Fractions to Decimals

Read the questions carefully and convert the fractions to decimals.

1. The volume of water in the container is $\frac{6}{10}$L but what is the volume of the container in decimals? _____

2. There shaded boxes is $\frac{3}{10}$ but what is the shaded boxes in decimals? _____





3. 5 hundredths These blocks represent $\frac{5}{100}$ what is this fraction as a decimal? _____

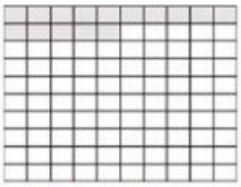

4. 15 hundredths These blocks represent $\frac{15}{100}$ what is this fraction as a decimal? _____

LIVEWORKSHEETS



89 hundredths

5. These blocks represent $\frac{89}{100}$ what is this fraction as a decimal? _____

6. What is $\frac{789}{100}$ as a decimal? _____

7. What is $\frac{546}{1000}$ as a decimal? _____

8. What is $\frac{436}{100}$ as a decimal? _____

9. What is $\frac{523}{100}$ as a decimal? _____

10. What is $\frac{25}{10}$ as a decimal? _____

LIVEWORKSHEETS