Lembar Kegiatan Peserta Didik

MERDEKA BELAJAR

Jodohkan hasil operasi hitung keliling bangun datar berikut!

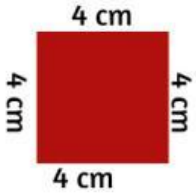

32 cm



12 cm

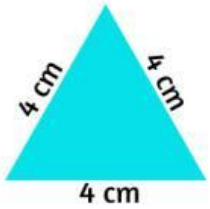

16 cm

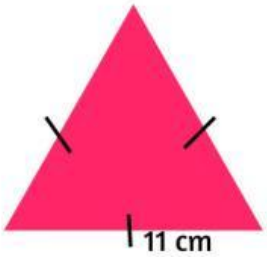

33 cm

Tuliskan nama anggota kelompok dan berikan ceklis, berikut:

	Membantu Mengerjakan LKPD	Memberikan pendapat saat diskusi	Memahami keliling bangun datar
1. _____			
2. _____			
3. _____			
4. _____			
5. _____			

LIVEWORKSHEETS